Escuela Millaray
Segundo B
Matemática

GUÍA MATEMÁTICAS UNIDAD DECENA CENTENA

Nombre: _____ **curso:** _____ **Fecha:** _____

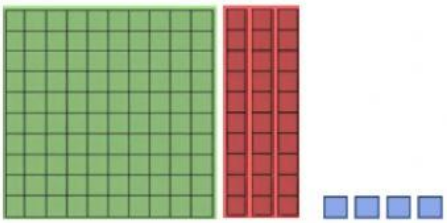

CENTENAS	DECENAS	UNIDADES

El número es: _____

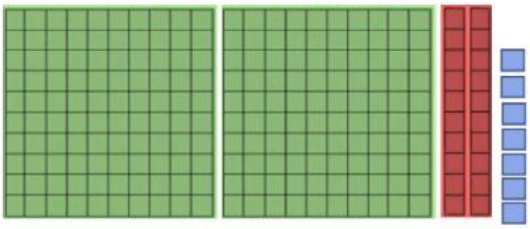

CENTENAS	DECENAS	UNIDADES

El número es: _____



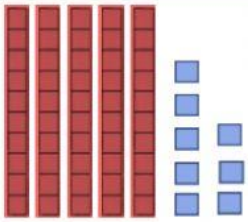

CENTENAS	DECENAS	UNIDADES

El número es: _____



CENTENAS	DECENAS	UNIDADES

El número es: _____

LIVEWORKSHEETS

Escuela Millaray
Segundo B
Matemática

Sumas

	C	D	U
	1	2	0
+		4	0

	C	D	U
	2	3	0
+		5	0

	C	D	U
	3	4	5
+		6	0

Restas

	C	D	U
	1	8	0
-		6	0

	C	D	U
	1	6	0
-		3	0

	C	D	U
	2	9	0
-	1	8	0

Sumas

1

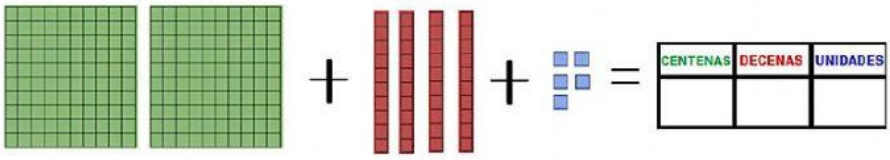

2

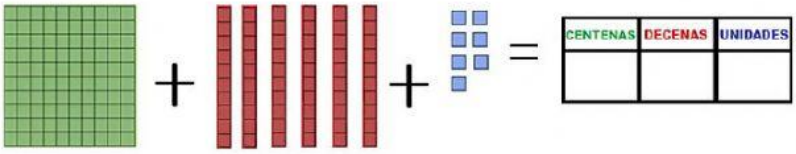

3

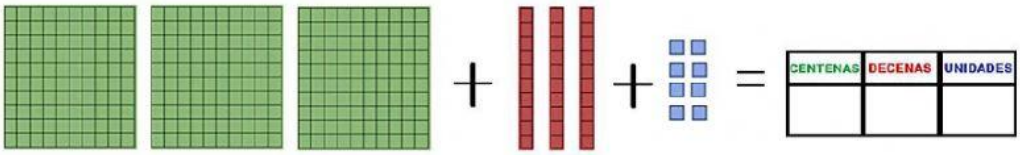

LIVEWORKSHEETS