Class Year 2

Pushes and Pulls

Look at the picture below, these action make things move in different direction. Choose the correct answers.



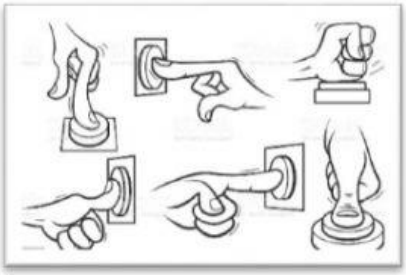

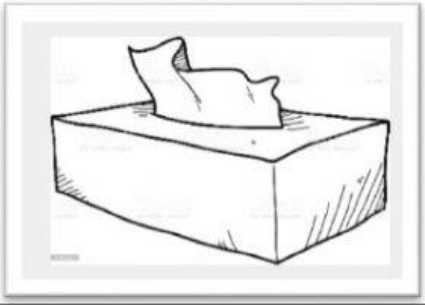

LIVEWORKSHEETS