Name: _____

Converting Hours and Minutes

Express the time in minutes.

h = hour(s) min = minute(s)

1. 1 h 40 min = ____ min
2. 2 h 25 min = ____ min
3. 5 h 50 min = ____ min

1 h = 60 min

2 h = 120 min

3 h = 180 min

4 h = 240 min

5 h = 300 min

6 h = 360 min

(skip counting 60)

Express the time in hours.

4. 180 min = ____ h
5. 360 min = ____ h
6. 240 min = ____ h

Express the time in hours and minutes.

Example:

190 min = 3 h 10 min

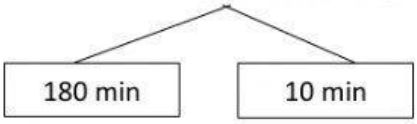

180 min = 3 h

190 min – 180 min = 10 min

So, 190 min = 3 h 10 min

7. 196 min = ____ h ____ min

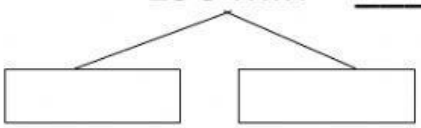

8. 255 min = ____ h ____ min

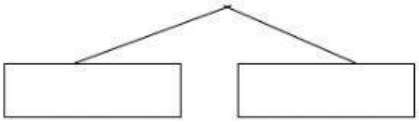

LIVEWORKSHEETS

Name: _____

9. 315 min = ____ h ____ min

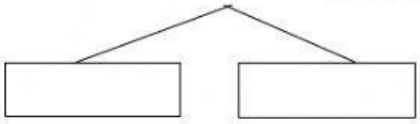

10. 290 min = ____ h ____ min

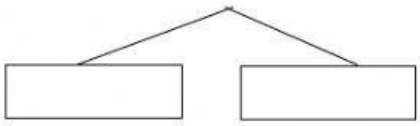

LIVEWORKSHEETS