*** Game Operasi Himpunan ***

Diketahui	Pindahkan angka ini ke Diagram Venn	Diagram Venn	Yang Ditanya	Kotak Jawaban	Pilihan Jawaban
A = {1,2,3} B = {2,3,4}	1 3 4 2	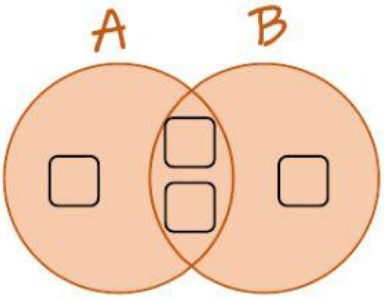	$A \cap B$		Pindahlah pilihan berikut ke kotak Jawaban yang benar! { 2, 3 }
A = {a, i, u, e, o} B = {a, b, c, d, e}	a b c d e i o u	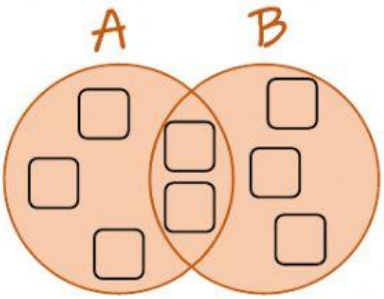	$A \cup B$		{ } { 5, 7} { 2, 4 }
A = {1,3,5,7} B = {1,2,3,4}	3 4 1 5 7 2	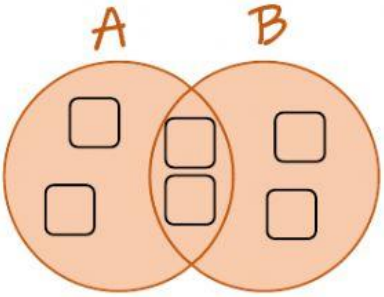	$A - B$		{a,b,c,d,e,i,u,o}
S = {1,2,3,4,5} A = {1,3,5}	1 2 3 4 5	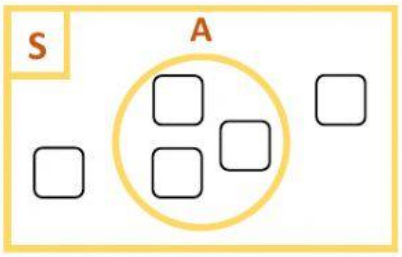	A^c		
S = {g,e,m,b,i,r,a} A = {e,m,a} B = {g,i,r}	g e m b i r a	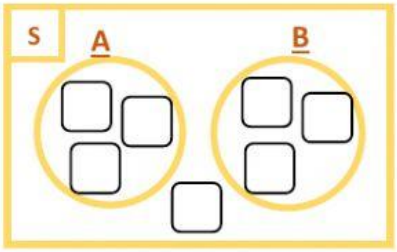	$A \cap B$		

LIVEWORKSHEETS
LIVEWORKSHEETS