EXAMEN BIMESTRAL DE GEOMETRÍA

INSTITUCIÓN EDUCATIVA PRIVADA
"SEMILLITAS DE VIDA"

PROFESORA: AILY MELISSA GUTARRA BONIFAZ

1. PERÍMETRO DE UNA FIGURA (Pulsa la alternativa correcta) Halla "x"

Perímetro del rectángulo = 90cm

- 2
- 3
- 4
- 5

Perímetro del cuadrado = 128cm

- 2
- 3
- 4
- 5

2. DIAGONALES DE UN POLÍGONO: (Marca la alternativa correcta)

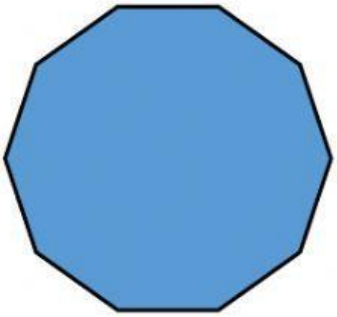

- 35
- 34
- 33
- 32

3. PERÍMETRO DE LA REGIÓN DE UN ROMBO: (Pulsa la alternativa correcta)

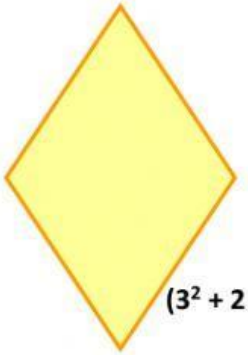

$(3^2 + 2 \times 6 - 8)$cm

- 52cm
- 13cm
- 21cm
- 50cm

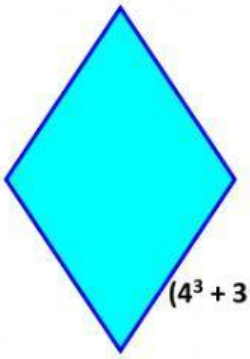

$(4^3 + 3 \times 4 - 26)$cm

- 50cm
- 64cm
- 76cm
- 200cm

4. SUMA DE ÁNGULOS EXTERIORES: (Marca la alternativa correcta) Halla "x"

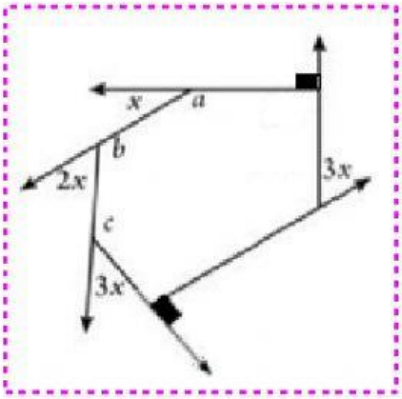

- 9x
- 360
- 180
- 20

PROFESORA: AILY MELISSA GUTARRA BONIFAZ

LIVEWORKSHEETS

5. PROPIEDAD AUXILIAR DE TRIÁNGULOS:(Marca la alternativa correcta) **Halla "x"**

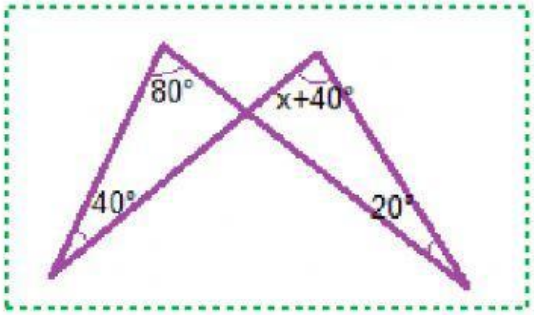

- 60
- 100
- 40
- 120

6. PERÍMETRO DE UNA FIGURA:(Marca la alternativa correcta)

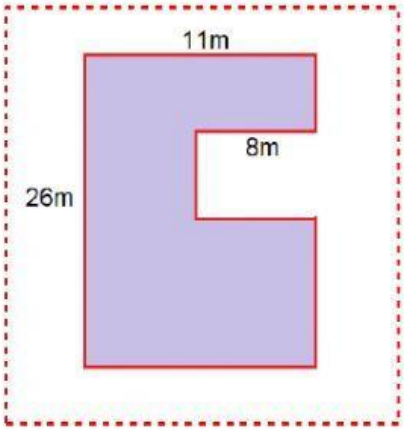

- 90
- 100
- 80
- 70

7. ÁNGULO EXTERIOR DE UN TRIÁNGULO: :(Marca la alternativa correcta)

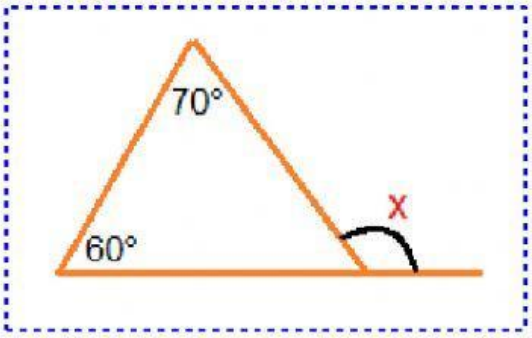

- 10°
- 130°
- 140°
- 120°

PROFESORA: AILY MELISSA GUTARRA BONIFAZ

LIVEWORKSHEETS