Usa los dibujos para plantear las operaciones.

**5.**



..... × ..... = 15

..... × ..... = 15

**6.**



..... × ..... = 14

..... × ..... = 14

**7.**



..... × ..... = 16

..... × ..... = 16

**8.**

..... × ..... = 12

..... × ..... = 12

LIVEWORKSHEETS