2-Dimensional Shapes: Name the Shape

Directions: Name the shape. Write the number of sides and angles. Choose from the shapes below.

square	rectangle	hexagon	trapezoid
	parallelogram	triangle	

Shape	Name	Number of Sides	Number of Angles
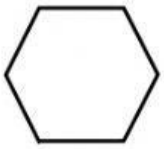			
			
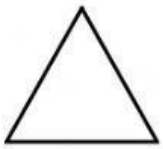			
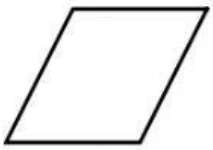			
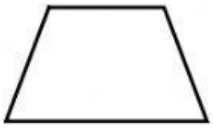			

LIVEWORKSHEETS