Nombre: _____ Fecha: _____

FICHA 9: Los números del 20 al 29

- Completa las series.

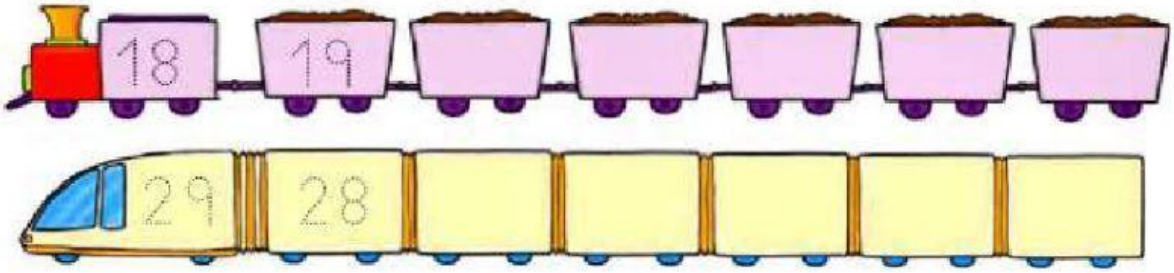

- Cuenta y completa.

☐ decenas y ☐ unidades

☐ + ☐ = ☐



☐ decenas y ☐ unidades

☐ + ☐ = ☐

- Une. Después completa.

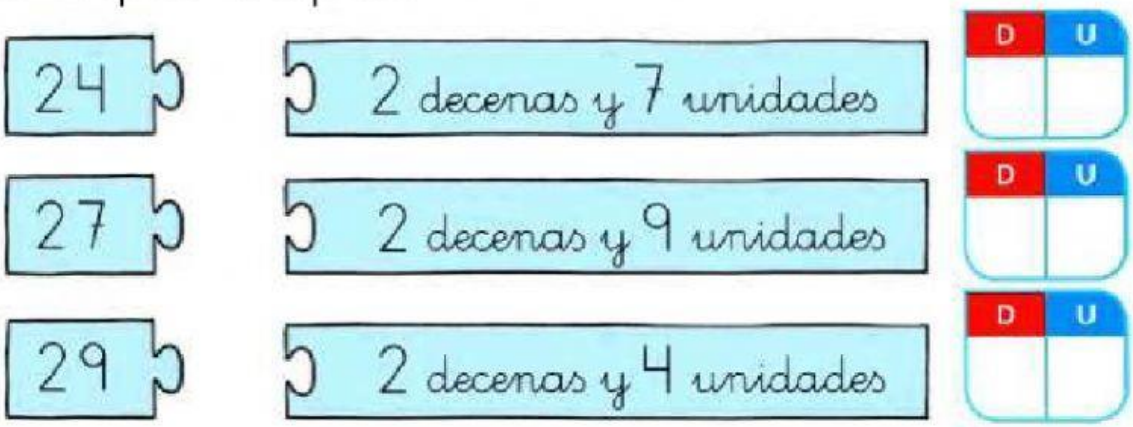

LIVEWORKSHEETS