Nome

Data

Oficina de Matemática – Year 3

Encontre a área e o perímetro das figuras indicadas

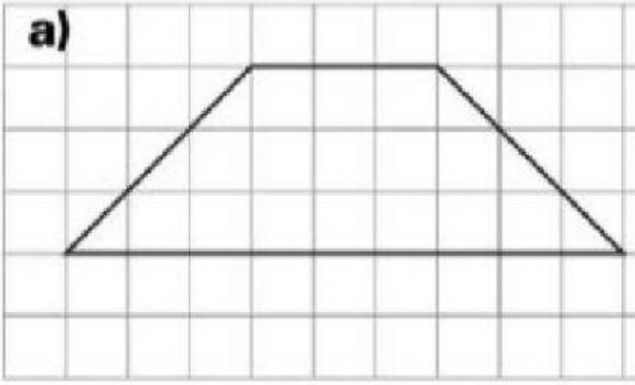

Área = _____ Unidades quadradas

Perímetro = _____ cm

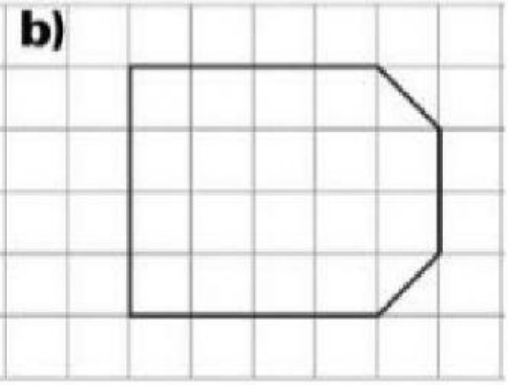

Área = _____ Unidades quadradas

Perímetro = _____ cm

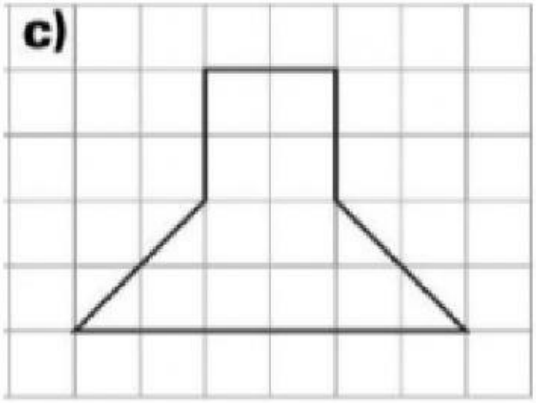

Área = _____ Unidades quadradas

Perímetro = _____ cm

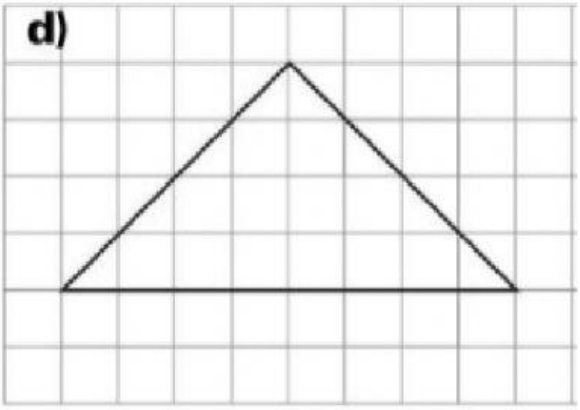

Área = _____ Unidades quadradas

Perímetro = _____ cm

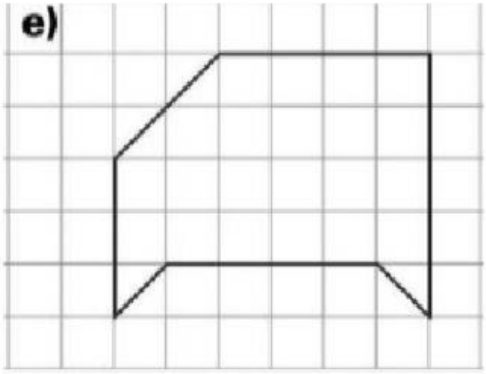

Área = _____ Unidades quadradas

Perímetro = _____ cm

LIVEWORKSHEETS