MATEMATIK TAHUN 1

KENALI JAM DAN WAKTU

LABELKAN **JARUM JAM** DAN **JARUM MINIT**

JARUM JAM **JARUM MINIT**

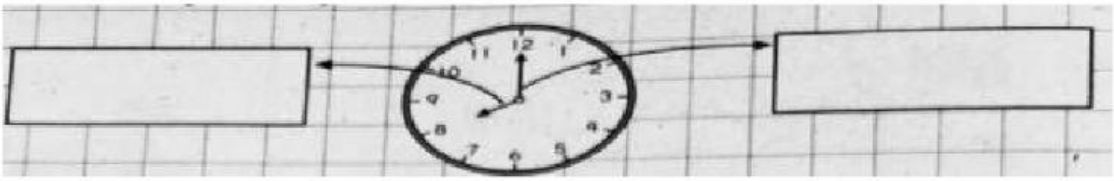

LIHAT BAHAGIAN YANG BERWARNA PADA MUKA JAM. PADANKAN JAWAPAN YANG BETUL.



Setengah jam

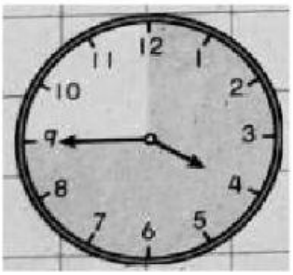

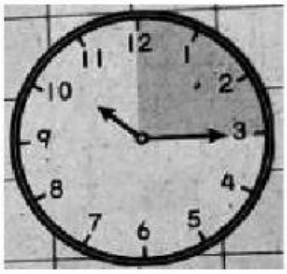

Suku jam

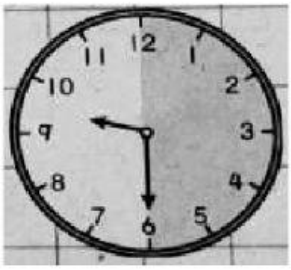

Tiga suku jam



LIVEWORKSHEETS