**Q.1) Fill in the missing box?**

2 + 2 + 2

3 groups of 2 = ?

a) 6
b) 9

**Q.2) Fill in the missing box?**

5 + 5 + 5

3 groups of ? = 15

a) 5
b) 7



LIVEWORKSHEETS

**Q.3) Fill in the missing box?**

? times 2 = 6

a) 3
b) 7

**Q.4) Fill in the missing box?**



3 times ? = 12

a) 4
b) 6

**Q.5) Choose the correct multiplication statement for the following repeated addition?**

? ✖ ? = ?

a) 4 x 6 = 24
b) 3 x 6 = 18

**Q.6) Fill in the missing box:**

4 groups of 2 4 ✖ 2 = ?

a) 6
b) 8

**Q.7) Fill in the missing box:**


LIVEWORKSHEETS

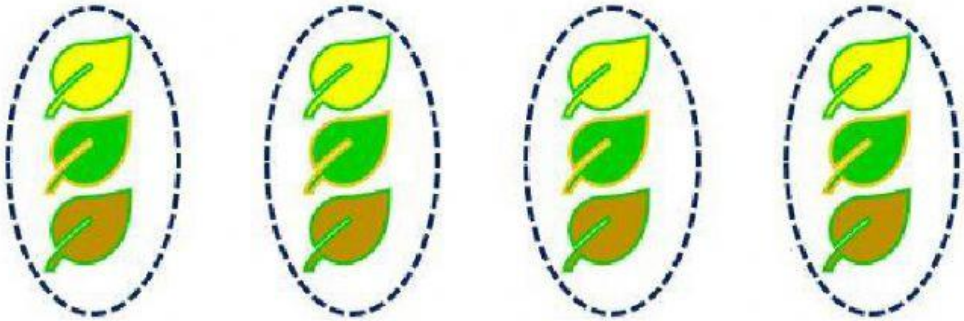

4 groups of 3 $\boxed{4} \times \boxed{3} = \boxed{?}$

a) 12
b) 13

**Q.8) Fill in the missing box:**

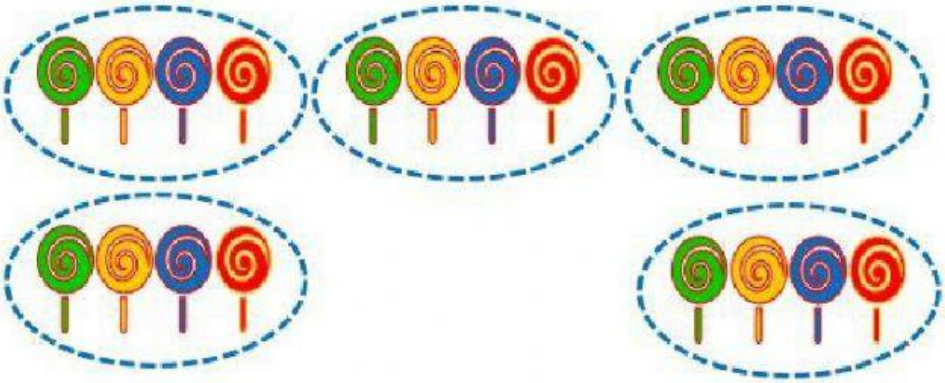

5 groups of 4 $\boxed{5} \times \boxed{4} = \boxed{?}$


LIVEWORKSHEETS

a) 23
b) 20

**Q.9) Fill in the missing box:**

**4 groups of 5** $\boxed{4} \times \boxed{5} = \boxed{?}$

a) 20
b) 29

## Multiplication Worksheets for Grade 1 - Correct Answers -

Q.1) a. 6
Q.2) a. 5
Q.3) a. 3
Q.4) a. 4
Q.5) b. 3 x 6 = 18
Q.6) b. 8
Q.7) a. 12
Q.8) b. 20
Q.9) a. 20

Arinjay Acad