# Guía de aprendizaje: Matemática

## ***Fracciones impropias y número mixto***

Nombre:_____Fecha:_____

I.L. Expresan fracciones impropias y números mixtos.

## *Ejemplos:*

| Representación gráfica | Fracción impropia | | Número Mixto |
|---|---|---|---|
|  | $\frac{5}{3}$ | $=$ | $1\frac{2}{3}$ |
| 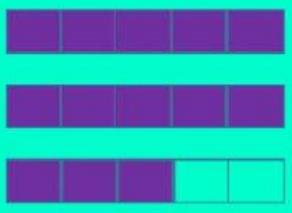 | $\frac{13}{5}$ | $=$ | $2\frac{3}{5}$ |

Toda fracción impropia la puedes expresar como número mixto.

LIVEWORKSHEETS

# *Ejercicios:*

Escribe la fracción impropia y el número mixto que corresponde a cada representación.

| Representación gráfica | Fracción impropia | Número mixto |
|---|---|---|
|  | $\frac{\square}{\square}$ | $\square\,\frac{\square}{\square}$ |
|  | $\frac{\square}{\square}$ | $\square\,\frac{\square}{\square}$ |
|  | $\frac{\square}{\square}$ | $\square\,\frac{\square}{\square}$ |
|  | $\frac{\square}{\square}$ | $\square\,\frac{\square}{\square}$ |
|  | $\frac{\square}{\square}$ | $\square\,\frac{\square}{\square}$ |
| 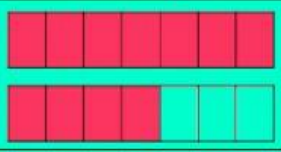 | $\frac{\square}{\square}$ | $\square\,\frac{\square}{\square}$ |
|  | $\frac{\square}{\square}$ | $\square\,\frac{\square}{\square}$ |

LIVEWORKSHEETS