Name: _____ Date: _____

Area of Rectangles and Squares

1	**The space inside an object or shape is called it's_____** a) area b) perimeter
2	**If each square represents 1 in, what is the area of this rectangle?**  a) $12in^2$ b) $14in^2$ c) $10in^2$
3	**How do you find the area of a rectangle?** a) Length + Length + Length + Length b) Length + breadth c) Length x breadth
4	**What is the area of this shape?** 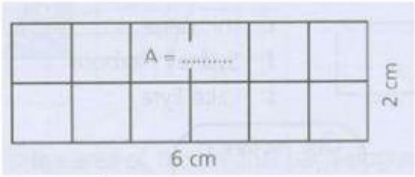 a) $12cm^2$ b) $8cm^2$ c) 16cm
5	**What is the area for this shape?** 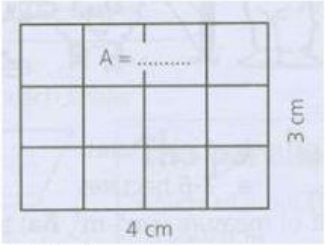 a) $7cm^2$ b)$12cm^2$ c) $14cm^2$

LIVEWORKSHEETS

6	**What is the area of this shape?** 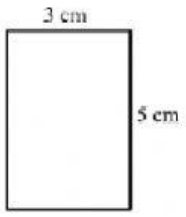 a) 8cm b) $15cm^2$ c) 16cm
7	**What is the area of this shape?** 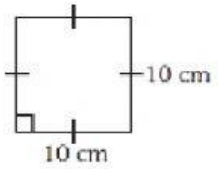 a) $100cm^2$ b) $20cm^2$ c) $40cm^2$
8	**A rectangle is 7m long and 4m wide. What is the area?** a) $22m^2$ b) $11m^2$ c) $28m^2$
9	**What is the area of a square with a side of 3 cm?** a) $9cm^2$ b) 6cm c) $12cm^2$
10	**Mickey has a square shaped table. One of the sides is 5 feet long. What is the area of the table?** a) 10 square feet b) 25 square feet c) 50 square feet
11	**Mrs. Corbin wanted to cover her living room with new carpet. If the length of the room was 11 feet and the width was 8 feet. How much carpet would she need to buy?** a) 88 square feet b) 19 square feet c) 22 feet

Good Luck!

LIVEWORKSHEETS