Centro Educacional Thuty

Nome:_____

Professora: _____ Data: _____

- Observe as figuras geométricas abaixo, selecione somente os triângulos amarelos.







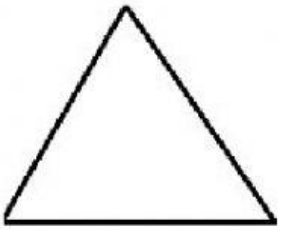

LIVEWORKSHEETS