Ⓑ 把图形里一半、超过一半或完整的格子画 ✓，然后数一数 "✓" 的数量，估计及写出图形的面积。 6.1.3 TP 2 TP 3 TP 4

1

图形的面积：_____ cm^2

2

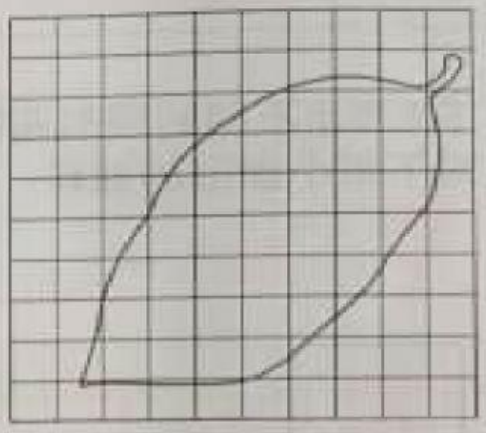

图形的面积：_____ cm^2

3

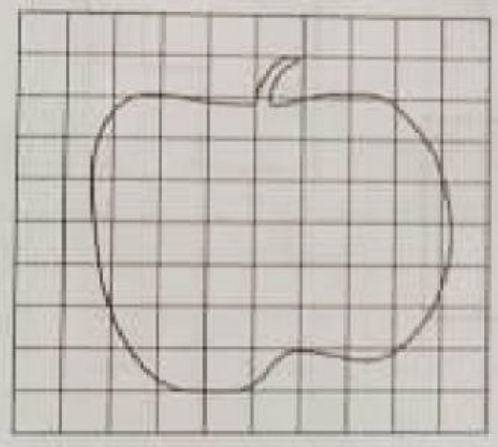

图形的面积：_____ cm^2

4

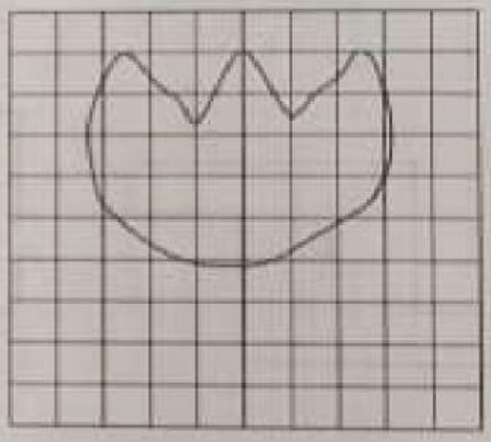

图形的面积：_____ cm^2

5



图形的面积：_____ cm^2

6



图形的面积：_____ cm^2

LIVEWORKSHEETS