CUADRILÁTEROS

1. Relaciona según corresponda:

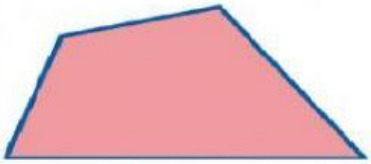

TRAPEZOIDE

ROMBO

ROMBOIDE

RECTÁNGULO

2. Calcula el valor de "x"

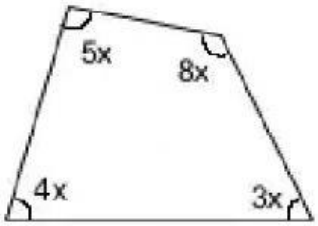

X=

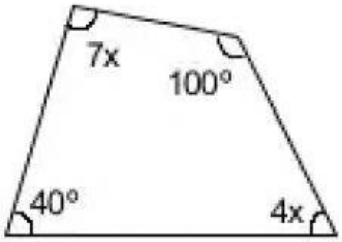

X=

LIVEWORKSHEETS

3. Arrastra cada elemento en el lugar que corresponde:

ángulo **diagonal** **vértice** **lado**

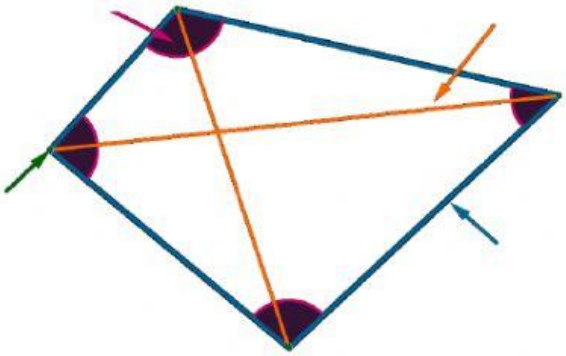

LIVEWORKSHEETS