Name: _____

Date: Thursday, September 23, 2021

1) Count forward to 20 by filling in the missing numbers.

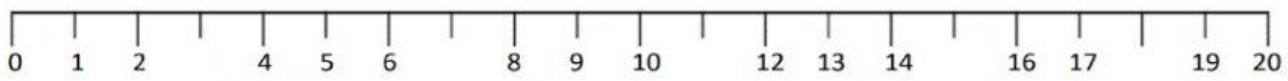

2) Which answer shows counting backward from 20 to 10?

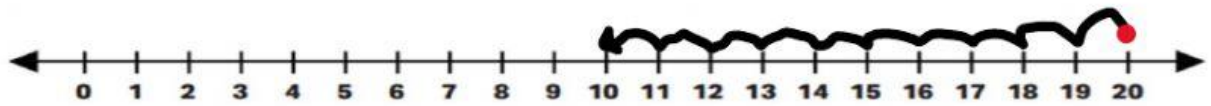

a) 20, 18, 16, 14, 10

b) 20, 19, 18, 17, 16, 15, 14, 13, 12, 11, 10

c) 20, 19, 17, 15, 18, 12

3) Which answer shows counting backward from 18 to 11?

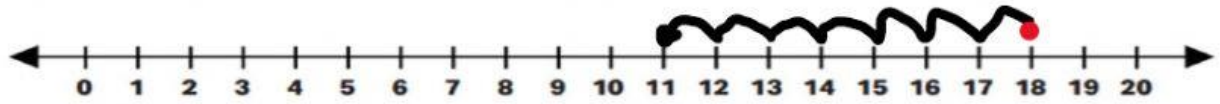

a) 18, 17, 16, 15 , 14, 13, 12, 11

b) 19, 18, 17, 16, 15, 14, 13, 12, 11, 10

c) 18, 17, 15, 18, 12

LIVEWORKSHEETS

4) Count backward to fill in the missing numbers.

a) 20 , , 18 , , 16 , , 14 , 13 , ,

b) 19 , , 17 , 16 , ,

LIVEWORKSHEETS