Year: 1
Topic: Numbers up to 100
Subtopic: Tens and Ones

Look at the pictures. Then, fill in the blanks.

1.

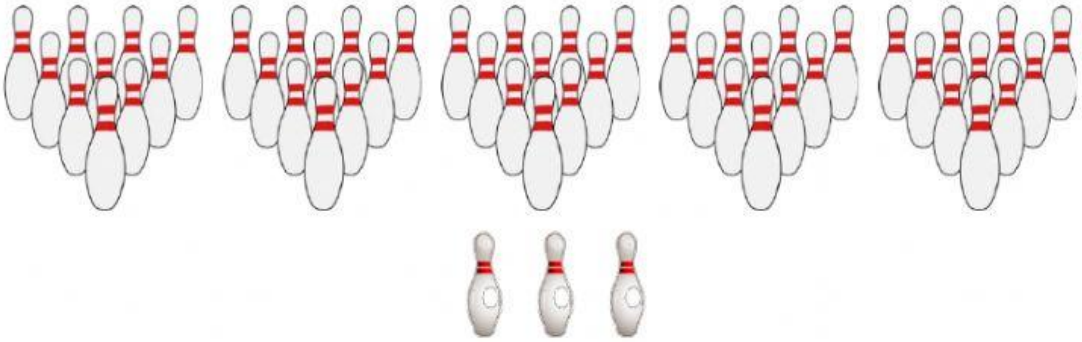

_____ = _____ tens _____ones

2.

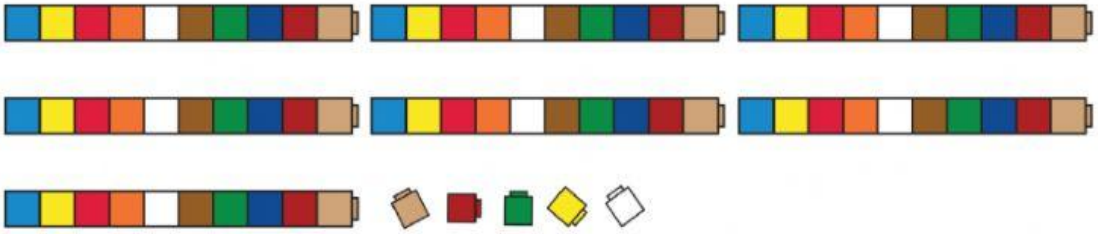

_____ = _____ tens _____ones

3.

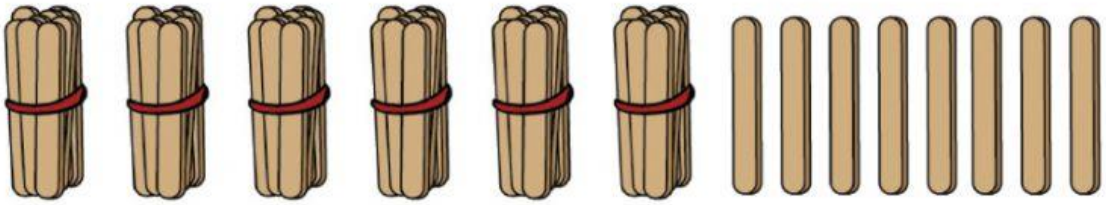

_____ = _____ tens _____ones

RHS/ONLINELEARNING/2021

LIVEWORKSHEETS

4.

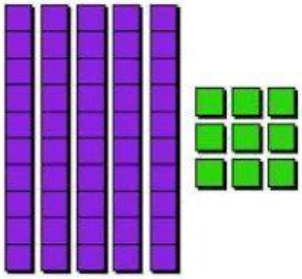

_____ = _____ tens _____ones

5.

_____ = _____ tens _____ones

6.

_____ = _____ tens _____ones

7.

_____ = _____ tens _____ones

RHS/ONLINELEARNING/2021

LIVEWORKSHEETS

8.

_____ = _____ tens _____ones

9.

_____ = _____ tens _____ones

10.

_____ = _____ tens _____ones

RHS/ONLINELEARNING/2021

LIVEWORKSHEETS