∞BISMILLAAHIRRAHMAANIRRAHIIM∞

2D Shapes Properties

Answer the questions based on the instruction given.

1. Look at the picture below.



It is a _____.

It has ____ sides.

It has ____ vertices.

2. Match the pictures and their properties.

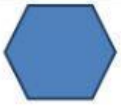	•	•	It has 3 sides and 3 angles, all the angles are not right angles.
	•	•	It has 5 vertices and 2 right angles.
	•	•	It has 4 sides. All the angles are right angles
	•	•	It has 6 sides and 6 vertices.

3. Match the name of the shapes below with its properties.

It has 1 curved side and 1 straight side	•	•	Triangle
It has 5 straight sides and 5 vertices	•	•	Semicircle
It has 3 straight sides and 3 vertices	•	•	Pentagon
It has 10 straight sides and 10 vertices	•	•	Decagon

∞ALHAMDULILLAHIROBBIL'ALAMIIIN∞

pageborders.org

LIVEWORKSHEETS