Nome: _____

Data: _____

Oficina de Matemática – Year 2

1)



Perímetro = _____ cm

Área = _____ quadrados

2)



Perímetro = _____ cm

Área = _____ quadrados

3)



Perímetro = _____ cm

Área = _____ quadrados

4)

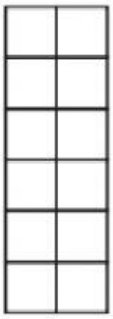

Perímetro = _____ cm

Área = _____ quadrados

5)



Perímetro = _____ cm

Área = _____ quadrados

6)

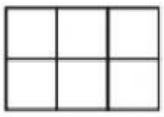

Perímetro = _____ cm

Área = _____ quadrados

7)



Perímetro = _____ cm

Área = _____ quadrados

8)



Perímetro = _____ cm

Área = _____ quadrados

9)

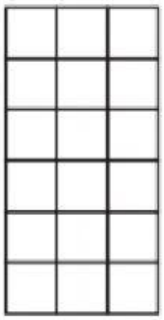

Perímetro = _____ cm

Área = _____ quadrados

LIVEWORKSHEETS