Friday 17th September, 2021
Weekly Tests
Mathematics
Section A :

Count the blocks then write the numerals in the boxes to show the correct number, the first one is done for you

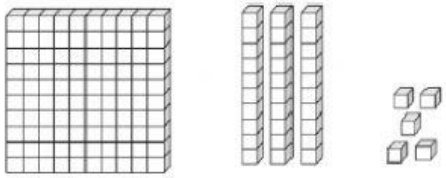

Hundreds	Tens	Ones
1	3	5

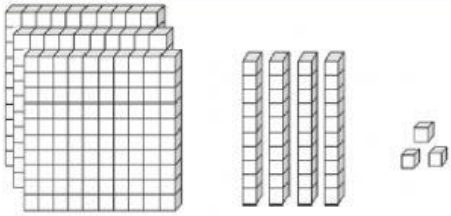

Hundreds	Tens	Ones

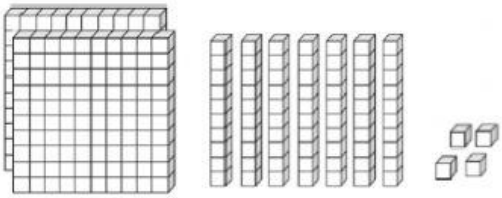

Hundreds	Tens	Ones

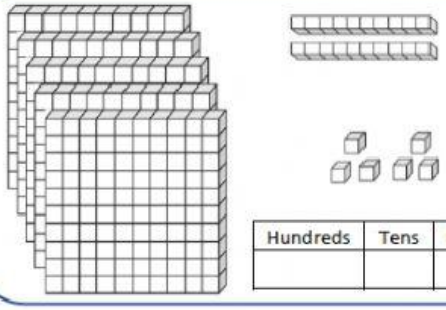

Hundreds	Tens	Ones

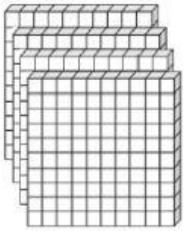

Hundreds	Tens	Ones

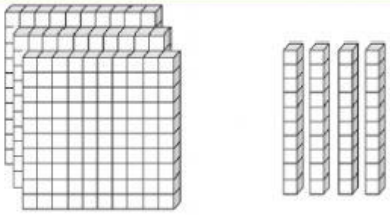

Hundreds	Tens	Ones

15marks

LIVEWORKSHEETS



Section B : Count on to complete the shell sequence.

1. 40 +4 +4 +4

2. 60 +10 +10 +10

3. 100 110 +10 +10 +10

4. 200 205 +5 +5 +5

10marks

LIVEWORKSHEETS