CIRCUNFERENCIA - PROPIEDADES

01-En el gráfico, calcular "x". Si "O" es centro de la circunferencia.

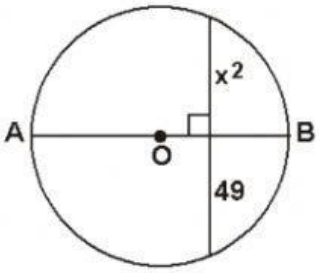

a) 6

b) 7

c) 8

d) 9

e) 5

02- En el gráfico, calcular "x", si: AB// CD

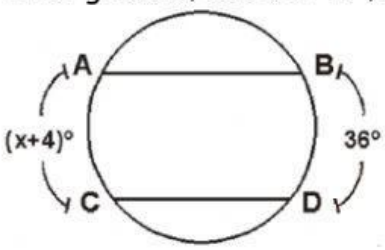

a) 29

b) 31

c) 28

d) 30

e) 32

03- En el gráfico, calcular: x, si P y Q son puntos de tangencia.

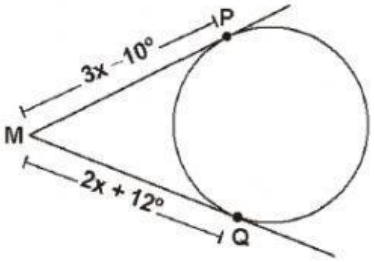

a) 25

b) 23

c) 24

d) 22

e) 20

04-En el gráfico, calcular: "x"

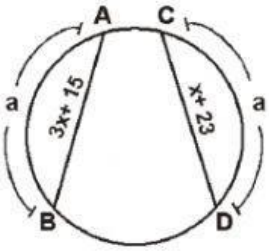

a) 6

b) 7

c) 4

d) 3

e) 5

05- Si P, Q y R son puntos de tangencia, calcular "x" en la figura:

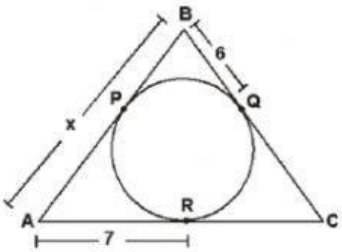

a) 13

b) 17

c) 18

d) 19

e) 15

LIVEWORKSHEETS