Nombres y apellidos.....

1. Las líneas se forman gracias a la sucesión de:

líneas	puntos	ninguno

2. Existen.....tipos de líneas: .....,.

..... y .....

3. Relaciona la imagen con el nombre de cada línea.

cuerva	recta vertical	recta horizontal
mixta	ondulada	recta inclinada



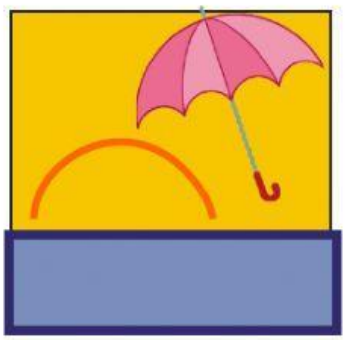



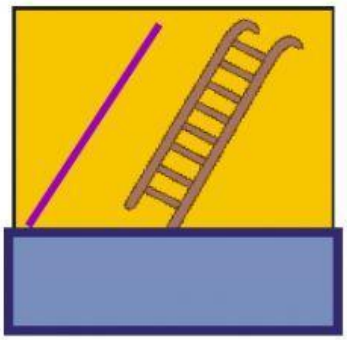



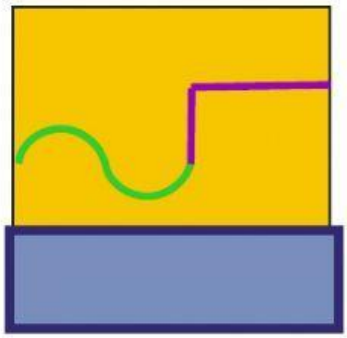

LIVEWORKSHEETS