MATHEMATICS DIAGNOSTIC TEST

Write each number in words:

1) 13 _____

2) 548 _____

Write the following as figures:

3) seventy-one _____

4) three hundred and two _____

Which set (s) below have an even number of objects? _____

5) Set A Set B Set C Set D

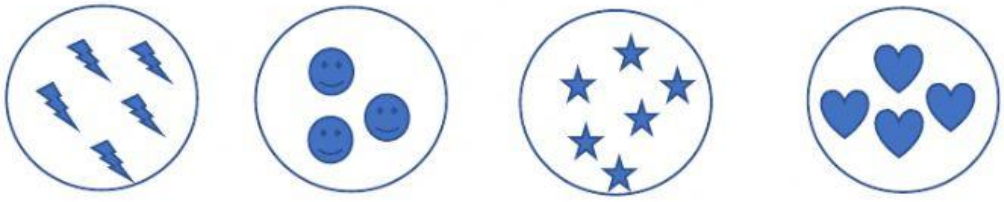

Use the digits (5, 9, 2) to make

6) The largest odd number _____

7) The smallest even number _____

Use < , > , = to make each statement correct

8) 4 + 10 ……. 2 x 7

9) 25 - 5 ……. 25 ÷ 5

LIVEWORKSHEETS

Complete the pattern

10) 23 24 26 ____ 33

11) 99 ____ 95 93 91

Write the following in expanded form.

12) 275 = two hundreds + _____ tens + 5 ones

13) 36 = _____ ones

Use the numbers in the box below to answer the following questions

75	**23**	**48**	**62**	**12**	**93**	**39**

14) Re-write the numbers in the box in descending order.

_____

15) What is the sum of the largest and smallest numbers?

_____

In the number 6<u>5</u>32

16) What is the value of the **underlined digit**? _____

17) Which number is in the **tens** column? _____

LIVEWORKSHEETS

Look at the following animals carefully and answer the questions which follow.



18) Which animal is 4th place? _____

19) In what position is the deer? _____

20) If Bear crossed the finish line at 10: 00 a.m. and Turtle crossed 15 minutes later. At what time did turtle finish the race?

Complete the following carefully.

21)
$$\begin{array}{r} 6\ 3\ 7 \\ +\ 1\ 2\ 4 \\ \hline \end{array}$$

---

22)
$$\begin{array}{r} 9\ 5\ 1 \\ -\ 4\ 3 \\ \hline \end{array}$$

---

23) What is the **product** of 57 and 4?

LIVEWORKSHEETS

24) **Divide** 42 marbles equally among 3 boys.

25) How **much more** is 169 than 35?

26) What fraction of the shape below is **shaded**? _____

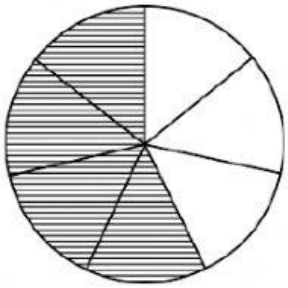

28) How many times can 5 be taken from 45?

29) Which statement is correct?

a) A > B

b) A = B

c) A < B

Figure A

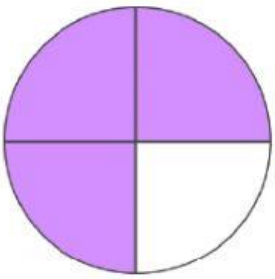

Figure B

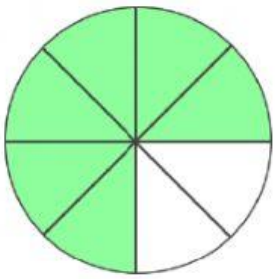

LIVEWORKSHEETS