1 Markatu X zuzenak diren esaldiak

Orain 8 eta erdiak dira, eta ordu erdi barru, 09:00ak izango dira.

Laukiek 5 alde dituzte.

06:30ak baino bi ordu lehenago, 08:30ak dira.

Karratuek 4 alde berdin dituzte.

2 Idatzi BA (bakoiti) edo BI (bikoitia) den zenbakien azpian

36 – 45 – 100 – 88 – 21 – 99 – 17 – 50 – 64

2 Jarri B (bai) edo E (ez) ordu bera adierazten duten erloju digitaleen azpian



4 Kokatu eta kalkulatu.

98 – 45



34 + 4 + 44

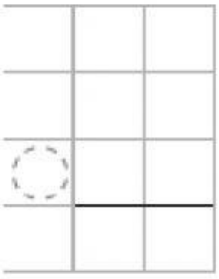

64 + 27

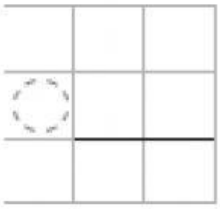

LIVEWORKSHEETS