ให้นักเรียนพยากรณ์สิ่งที่จะเกิดขึ้นในรูปที่ 9 โดยนำรูปลงไปเติมในช่องว่าง

คะแนนเต็ม
3 คะแนน







คะแนนเต็ม
3 คะแนน

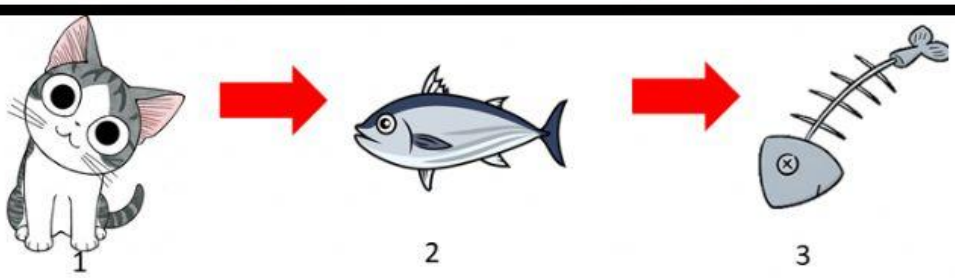



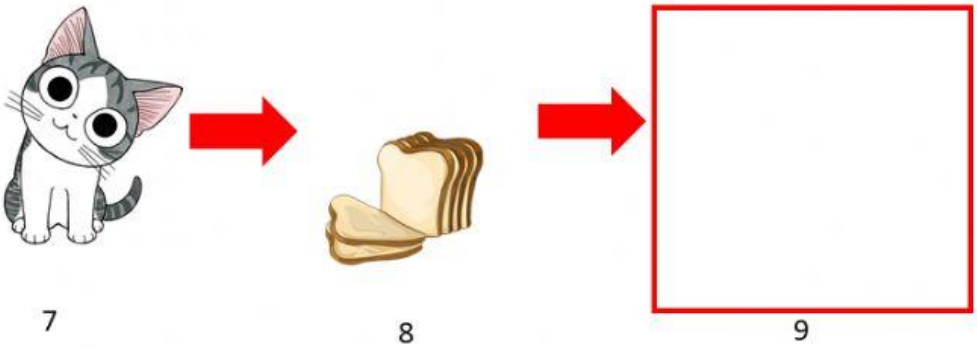

ชื่อ.....ชั้น.....

LIVEWORKSHEETS