Nome: _____

Data: _____

Oficina de Matemática – Year 2

1)

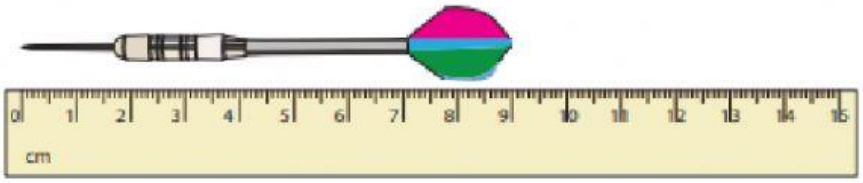

_____ cm

2)

_____ cm

3)



_____ cm

4)

_____ cm

5)

_____ cm

6)



_____ cm

LIVEWORKSHEETS