VFiS Vietnam Finland International School

Ngày ..... tháng ..... năm 20.....

Họ và tên: ..... Lớp: .....

PHÉP CỘNG CÓ TỔNG BẰNG 10

Exercise 1: Draw and count

1.

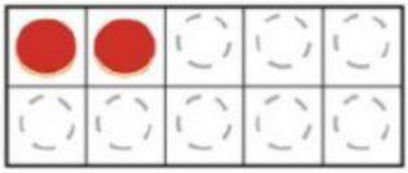

2 + 8 = 10

2.

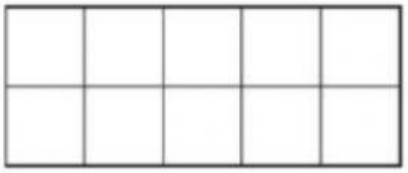

0 + ____ = 10

3.

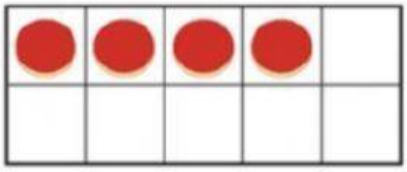

4 + ____ = 10

4.

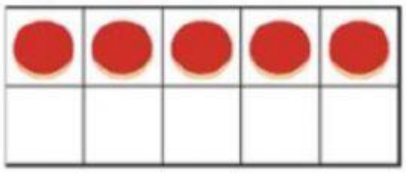

5 + ____ = 10

Exercise 2: Making tens

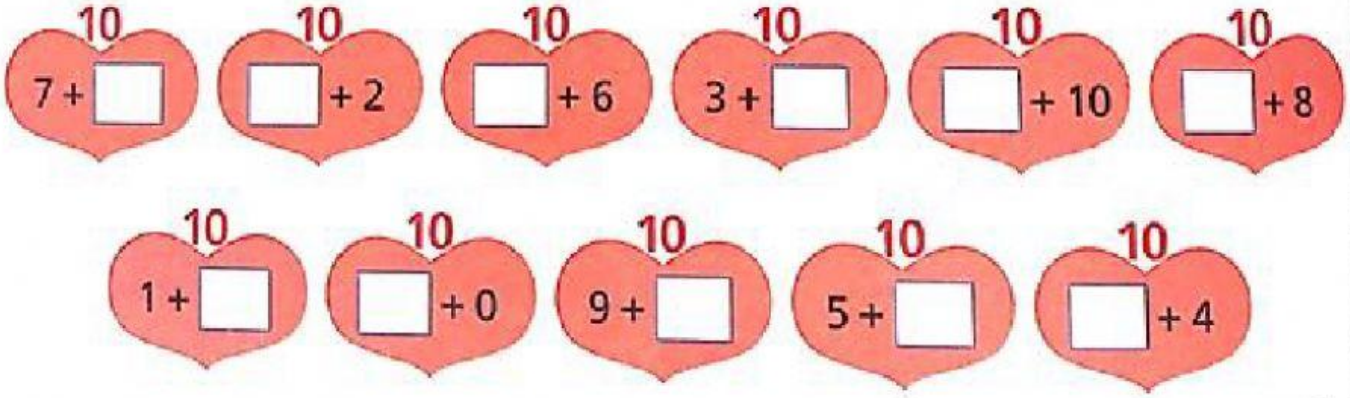

Exercise 3: Circle the two numbers that make 10.

7 + 6 + 3 =	5 + 5 + 5 =	4 + 1 + 6 =
6 + 4 + 8 =	9 + 2 + 1 =	2 + 8 + 9 =

LIVEWORKSHEETS

VFiS Vietnam Finland International School

Ngày ..... tháng ..... năm 20.....

Họ và tên: ..... Lớp: .....

PHÉP CỘNG CÓ TỔNG BẰNG 10

Exercise 4: Highlight sums of 10.

How many **"10s"** you found: .....

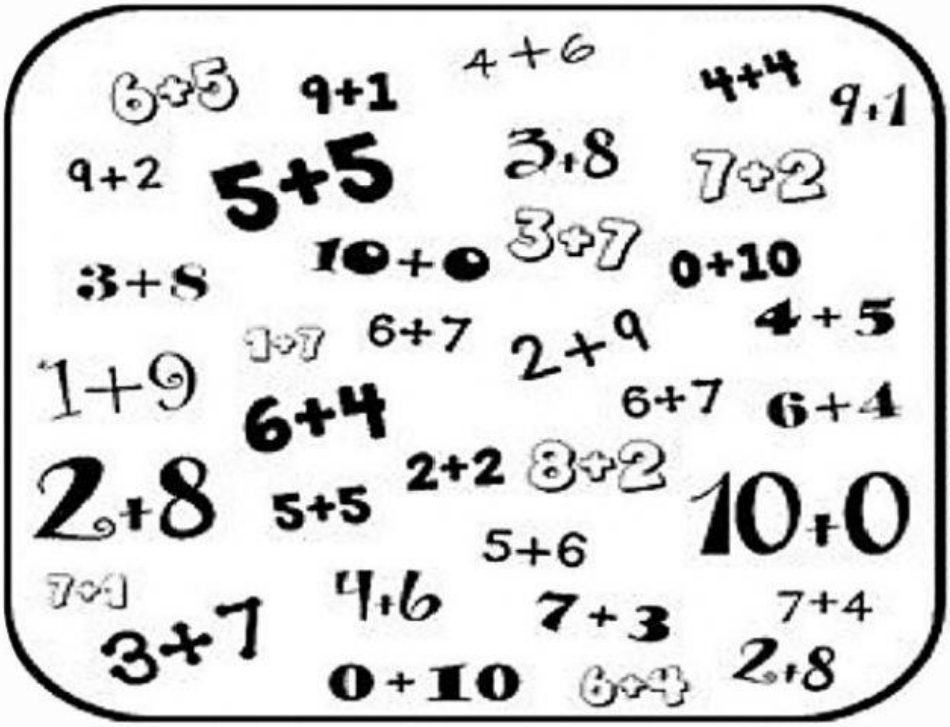

Exercise 5: Count and match to make sum of 10.

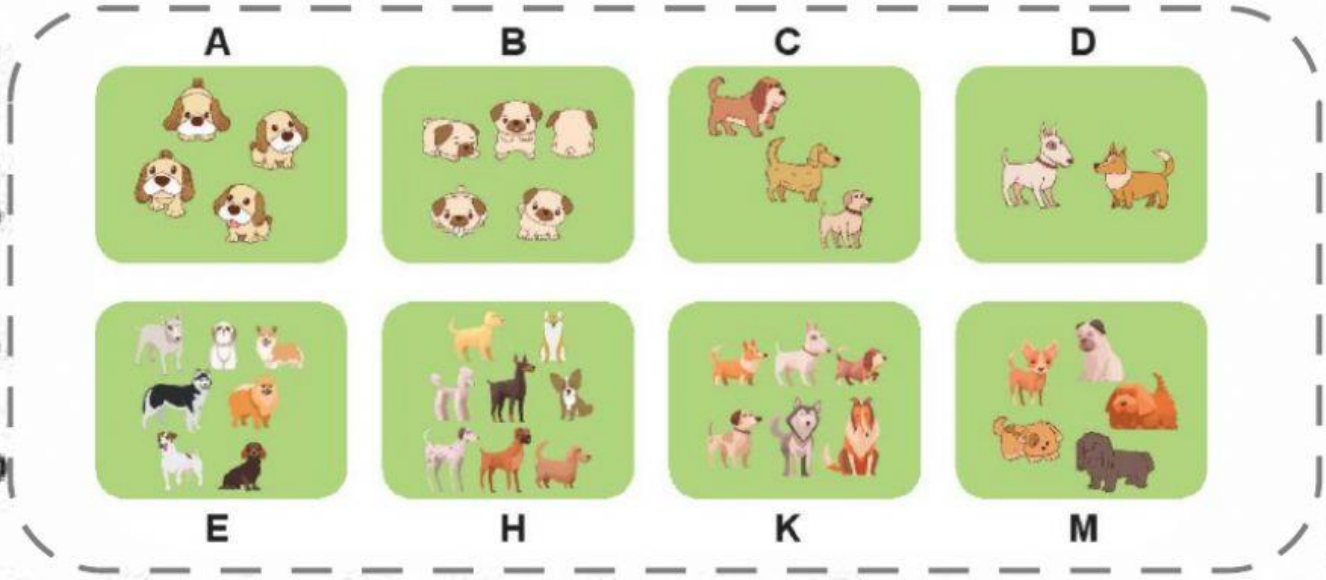

LIVEWORKSHEETS

VFiS Vietnam Finland International School

Ngày ..... tháng ..... năm 20.....

Họ và tên: ..... Lớp: .....

RAINBOW TO 10



0 + 10 = 10	10 + 0 = 10
__ + __ =	__ + __ =
__ + __ =	__ + __ =
__ + __ =	__ + __ =
__ + __ =	__ + __ =
__ + __ =	__ + __ =

Extra Worksheet

LIVEWORKSHEETS

VFiS Vietnam Finland International School

Ngày ..... tháng ..... năm 20.....

Họ và tên: ..... Lớp: .....

Number bonds to 10

Can you find the missing number bond to make 10 in the robot's tummy?

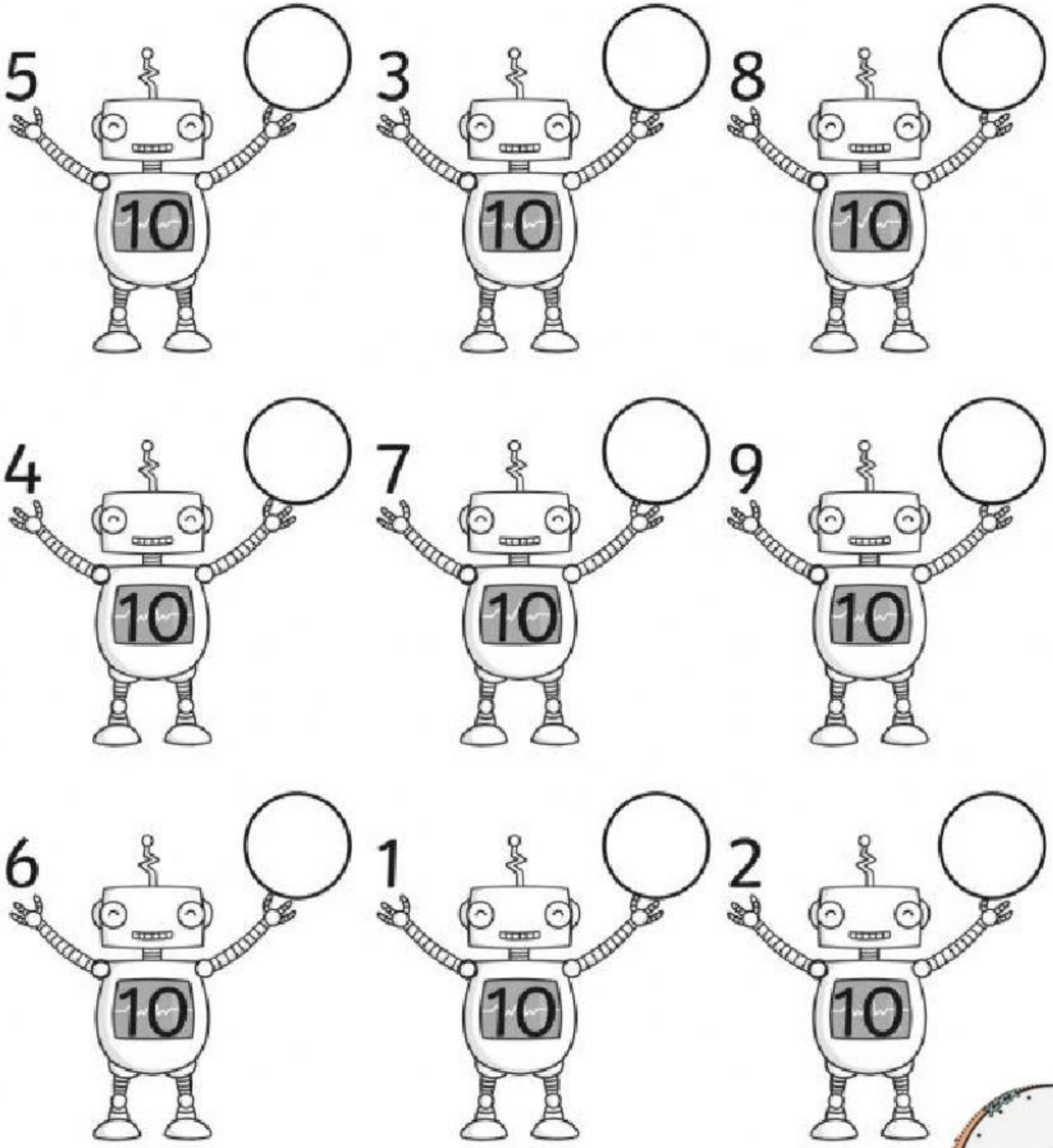

Extra Worksheet

LIVEWORKSHEETS