Grade 1

REVIEW NUMBERS FROM 1 TO 5

Exercise 1. How many object in each group?

Điền vào ô trống số con vật trong mỗi nhóm?







Exercise 2. Match. Nối



1	Three
3	One
5	Four
2	Five
4	Two

LIVEWORKSHEETS