EP4 Science

Volume

Write the volume of each object in cm^3.

1) 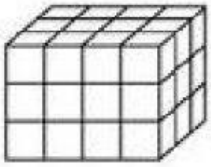

_____ cm^3

2) 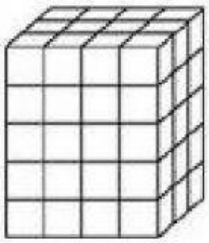

_____ cm^3

3) 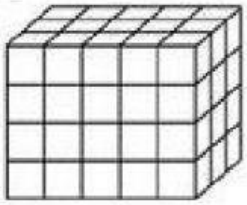

_____ cm^3

4) 

_____ cm^3

5) 

_____ cm^3

6) 

_____ cm^3

7) 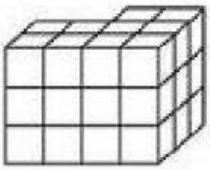

_____ cm^3

8) 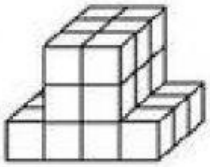

_____ cm^3

9) 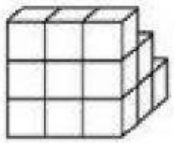

_____ cm^3

10) 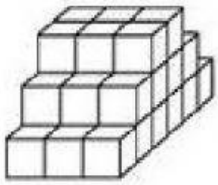

_____ cm^3

11) 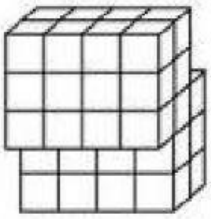

_____ cm^3

12) 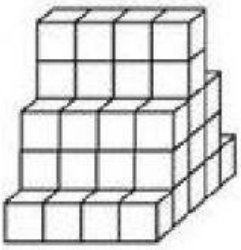

_____ cm^3

LIVEWORKSHEETS