masa DAN

WAKTU

Nyatakan minit pada muka jam di bawah.

3:05

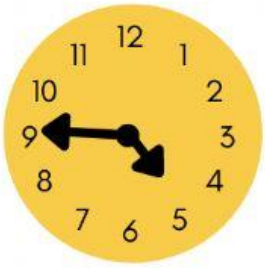

_____



_____

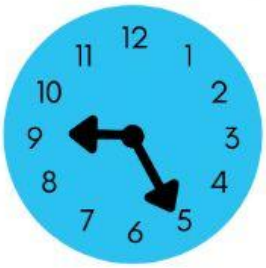

_____

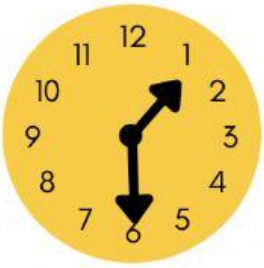

_____

_____

_____

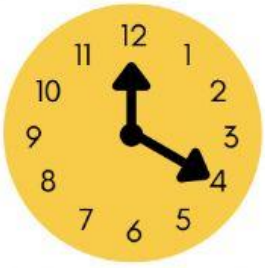

_____

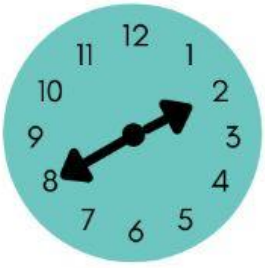

_____

LIVEWORKSHEETS