KENDRIYA VIDYALAYA SANGATHAN

CLASS 3 MATHEMATICS TOPIC:TIME

Q. Trace the time in the clock and circle the correct time from the options:

(a) 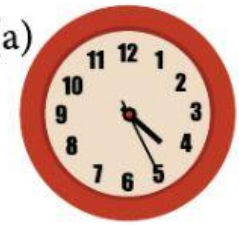

4:30

4:25

5:20

(b) 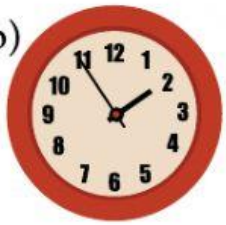

2:55

1:55

2:00

(c) 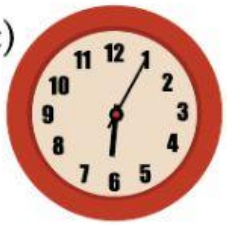

6:05

6:00

5:05

(d) 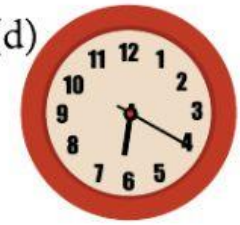

6:20

6:25

5:20

(e) 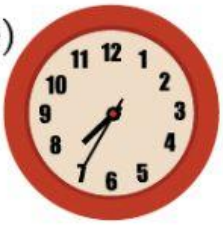

7:35

8:35

8:00

(f) 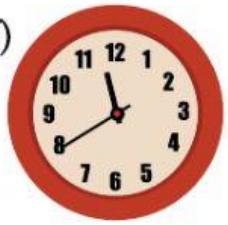

11:55

11:40

12:45

(g) 

12:55

1:00

12:45

(h) 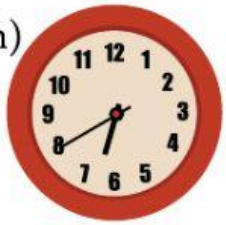

6:40

7:40

7:45

(i) 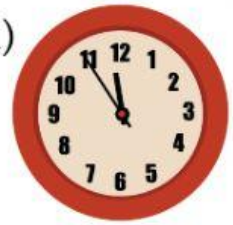

11:55

11:40

12:45

(j) 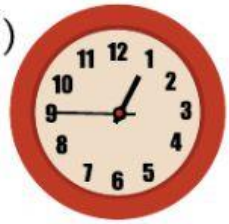

12:45

1:00

1:45

(k) 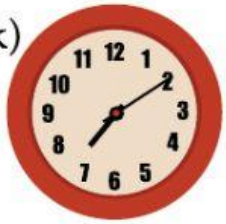

7:10

7:15

7:05

(l)

5:20

5:25

6:25

(m) 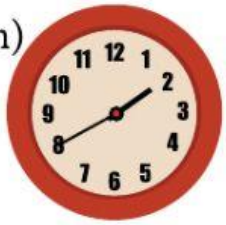

2:40

1:30

1:40

(n) 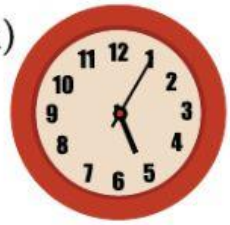

5:05

1:25

1:30

(o) 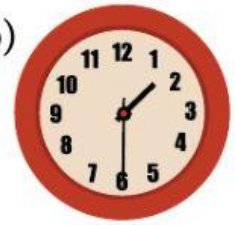

1:30

1:00

1:35

(p) 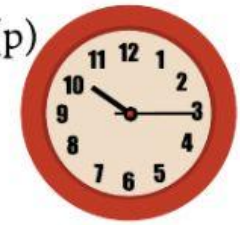

10:15

10:45

10:00

(q) 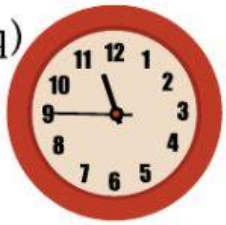

11:45

12:45

11:50

(a) 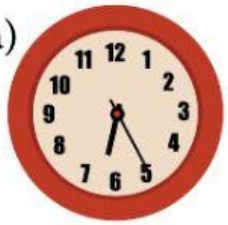

6:30

6:25

6:35

LIVEWORKSHEETS