KENDRIYA VIDYALAYA ONGC ANKLESHWAR
CLASS – 5 A & B WORKSHEET
HOW MANY SQURES?

1. Find the perimeter of the following:

(a)



.....

(b)



.....

2. Find the area of the following figures?

(a) .....

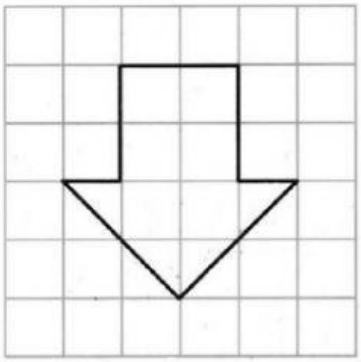

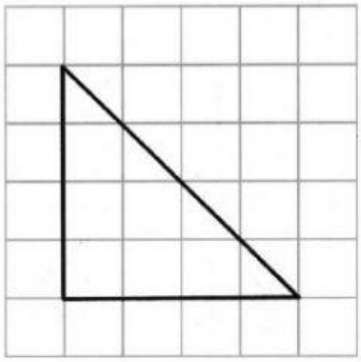

(b).....

LIVEWORKSHEETS

KENDRIYA VIDYALAYA ONGC ANKLESHWAR
CLASS – 5 A & B WORKSHEET
HOW MANY SQURES?

(c).....



4. What is the area of the shaded part?

(a) .....

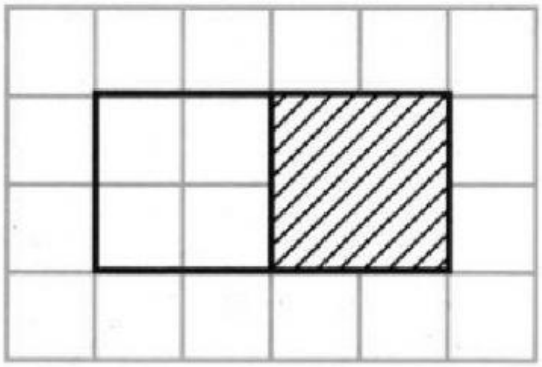

(b) .....

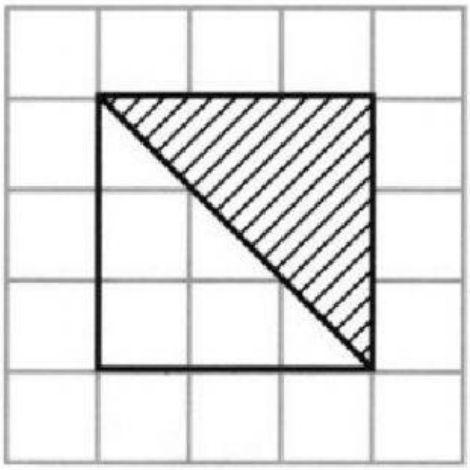

LIVEWORKSHEETS