PROBLEMA 1 :

En el romboide **ABCD**. Calcular **"x"**

A) 12°
B) 15°
C) 10°
D) 8°
E) 20°

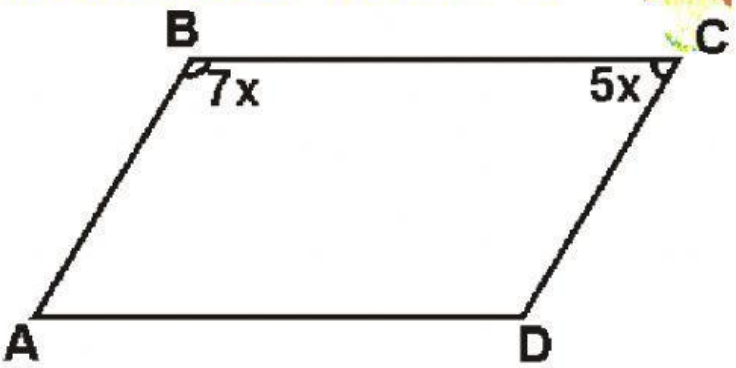

PROBLEMA 2 :

Calcular **"x"**

A) 12°
B) 13°
C) 17°
D) 14°
E) 27°

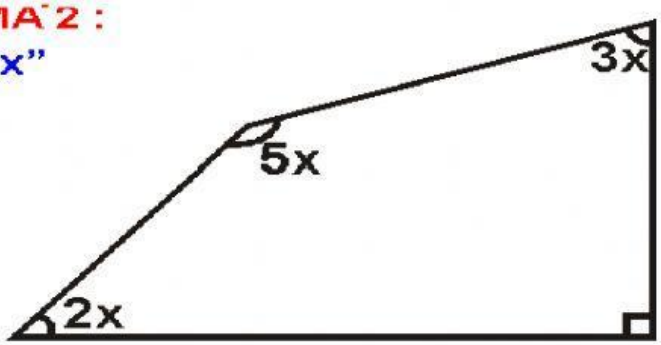

PROBLEMA 3 :

Si **ABCD** es un paralelogramo, calcular **"x"**

A) 24°
B) 36°
C) 20°
D) 72°
E) 28°

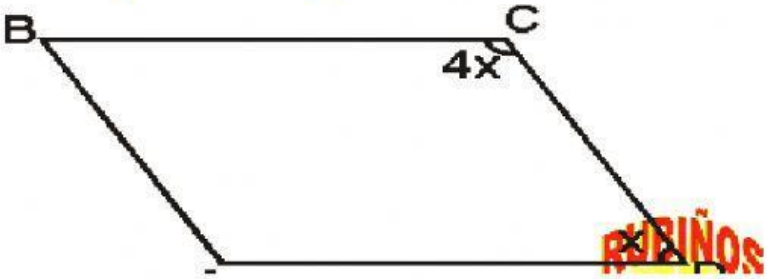

PROBLEMA 04 :

Si: **CD = 10u**, hallar la longitud del segmento que une los puntos medios de $\overline{AC}$ y $\overline{BD}$.

A) 4u
B) 3
C) 3,5
D) 5
E) 6

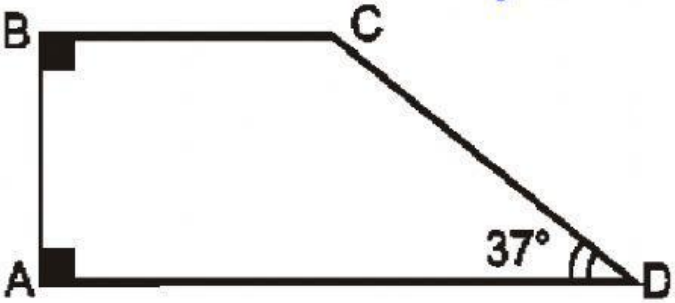

LIVEWORKSHEETS