Evaluation Math 7th

Simple interest.

Find the simple interest and amount on
Rs. 950.000 for 1 ¾ years at 15% per annum.

a. S.I =549.375 -A=2.500.000

b. S.I =249.375 -A=1.199.375

c. S.I =349.375 -A= 4.199.375

Find the simple interest and amount on
Rs. 600.000 for 3.5 years at 8 per annum.

a. S.I =168.000-A=768.000

b. S.I =468.000-A=968.000

c. S.I =649.375 -A= 3.199.375

LIVEWORKSHEETS

Find the simple interest and amount on
Rs. 528.000 for 1 ½ years at 15% per annum

a. S.I= 118.800 A=646.800
b. S.I= 618.900 A=946.800
c. S.I= 465.300 A=846.800

Find the simple interest and amount on
Rs. 350.000 for 1 years at 15% per annum

a. S.I=60.200 A=646.800
b. S.I= 18.900 A=64.700
c. S.I= 52.500 A=402.500

LIVEWORKSHEETS

Ram buys an article for $ 1800 and sells it at 10% loss. Find its selling price.

a. 1620
b. 5400
c. 8400
d. 5300

Find the cost price of an article when it is sold at a loss of 25% for $ 150.

a. 220
b. 300
c. 400
d. 200

PROFIT AND LOSS

LIVEWORKSHEETS

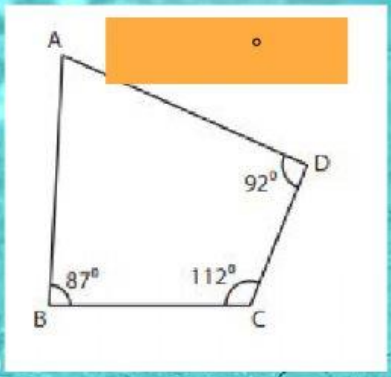

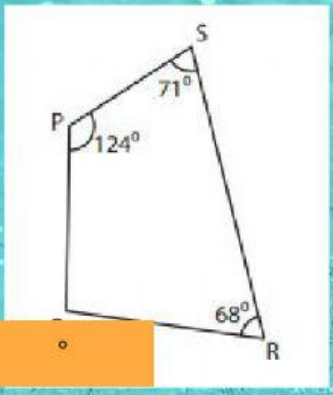

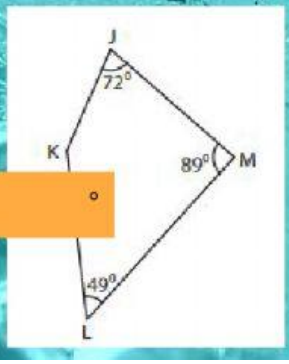

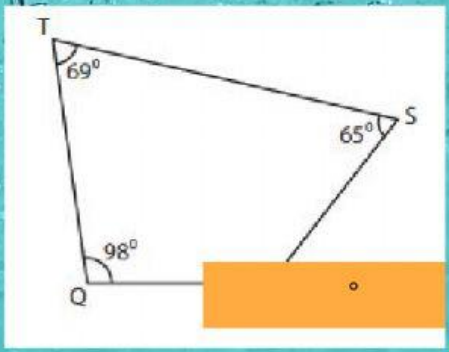

LIVEWORKSHEETS

Each day for a week in January, the highest temperatures in Perth were recorded.

Mon	Tues	Wed	Thurs	Fri	Sat	Sun
3°C	4°C	7°C	7°C	6°C	8°C	7°C

What is the mode of these temperatures?

_____

What is the mean of these temperatures?

_____

LIVEWORKSHEETS

Mohammed took 7 maths tests and got scores of 78, 81, 81, 84, 63, 72 and 77.

What was Mohammed's mode score?

78

63

81

LIVEWORKSHEETS

$25	$28	$29	$27	$25	$27	$27	$29	$31

a) What was the average price paid? (Mean)

b) What was the middle price paid? (Median)

c) What was the most common price paid? (Mode)

LIVEWORKSHEETS

Size 6	Size 7	Size 4	Size 6	Size 7	Size 7	Size 4	Size 6	Size 5



a) What was the average shoe size, to the nearest whole number? (Mean)

b) What was the middle shoe size? (Median)

c) What was the most common shoe size? (Mode)

LIVEWORKSHEETS