TAJUK : 3.2 TUKAR PECAHAN KEPADA PERPULUHAN

MATEMATIK TAHUN 2

Mudahnya Belajar Matematik Bersama Cikgu Najib

NAMA :

KELAS : TARIKH :

CUBA JAWAB.

1 Apakah pecahan bahagian merah.

a 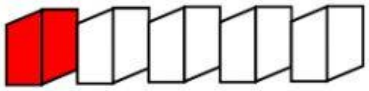 = $\frac{\square}{\square}$

b 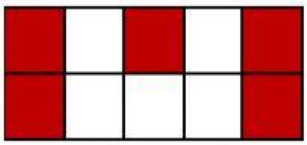 = $\frac{\square}{\square}$

2 Apakah perpuluhan bahagian biru.

a 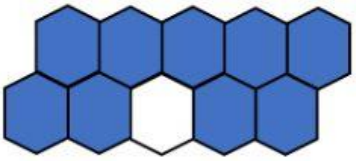 = ☐

b 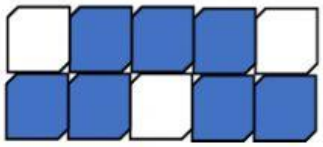 = ☐

3 Tukar pecahan kepada perpuluhan.

a $\frac{1}{10}$ = ☐

b $\frac{5}{10}$ = ☐

c $\frac{6}{10}$ = ☐

d $\frac{8}{10}$ = ☐

4 Manakah gambar rajah yang betul bagi perpuluhan yang diberi.

a **0.6**

i) 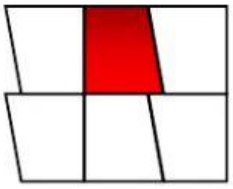

ii) 

iii) 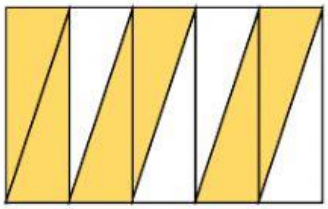

b **0.8**

i) 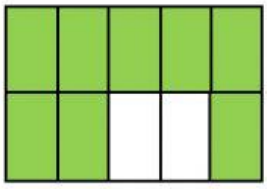

ii) 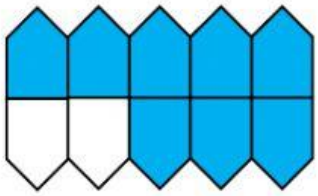

iii) 

SELAMAT BELAJAR.

LIVEWORKSHEETS