Relación de Pertenencia y No Pertenencia

Sean los conjuntos: Escribe $\in$ o $\notin$

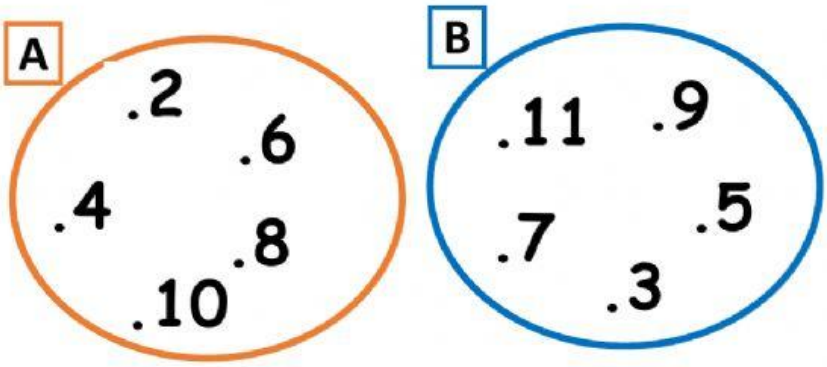



10	☐	A	$\in$
11	☐	A	$\notin$
8	☐	B	$\in$
6	☐	A	$\notin$
2	☐	B	$\in$
9	☐	B	$\notin$

LIVEWORKSHEETS

Escribe ∈ o ∉ según corresponde:

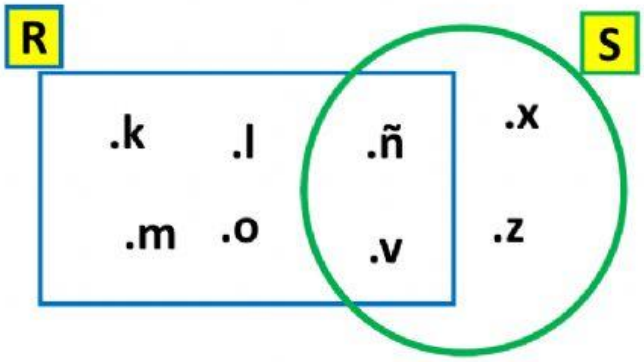

• x	☐	R	∈
• o	☐	S	∉
• ñ	☐	S	∈
• z	☐	R	∉
• v	☐	S	∉
• k	☐	S	∉

LIVEWORKSHEETS