COLEGIO BILINGÜE CEDAM

Math 6th

1. 60% of 422 = _____

2. 50% of 831 = _____

3. 6% of 9 = _____

4. 35% of 495 = _____

5. 3% of 20 = _____

LIVEWORKSHEETS

Math 6th

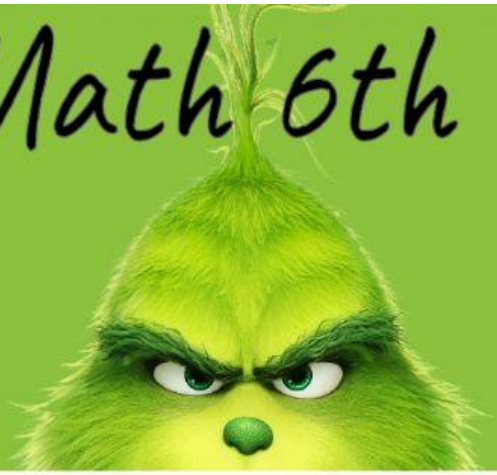

1. Find the new price of each item after the discount has been applied.

a) skateboard $9  discount 25% new price:

b) baseball hat $23 discount 10% new price:

LIVEWORKSHEETS

COLEGIO BILINGÜE CEDAM

Discount

c). leather jacket $85 discount 25% new price:_____

d) digital watch $120 discount 50% new price:_____

LIVEWORKSHEETS

e) soccer ball $18 discount 10% new price:_____

f) roller skates $78 discount 50% new price:_____

g) men's tie $45 discount 15% new price:_____

h) running shoes $50 discount 25% new price:_____

i) skipping rope $22 discount 10% new price:_____

j) fishing rod $30 discount 25% new price:_____

LIVEWORKSHEETS

COLEGIO BILINGÜE CEDAM

Choose the right answer

The term used to describe money gained after a sale

a. cost price
b. profit
c. selling price
d. loss

Laura sold a carpet for $10000, cost price of the carpet was 8000, find the profit or loss.

a. 2000 profit
b. 2000 loss
c. 8000 profit
d. 8000 loss

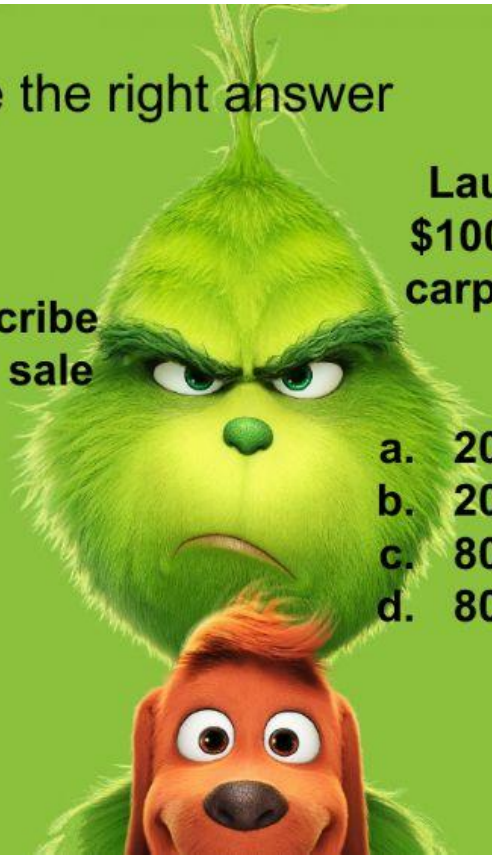

LIVEWORKSHEETS

COLEGIO BILINGÜE CEDAM

Choose the right answer

A man buy an article for $2750 and sells it for $2860. Find his profit percent.

a. 4%
b. 10%
c. 6%
d. 12%

If a camera is purchased for $490 and sold it for $465, find the loss percent.

a. 7.3%
b. 6.2%
c. 5.1%
d. 8%

LIVEWORKSHEETS

VOLUME

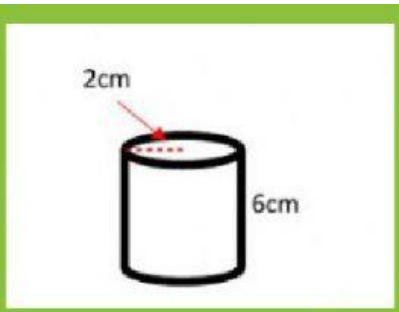

cm^3

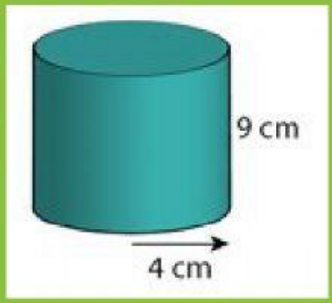

cm^3

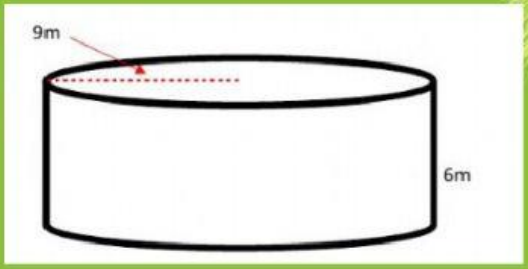

m^3

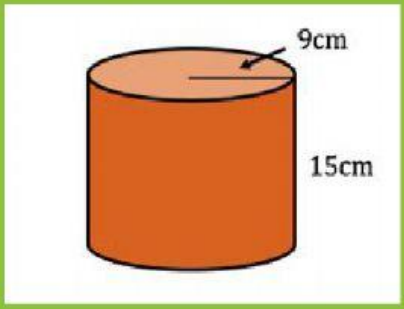

cm^3

LIVEWORKSHEETS

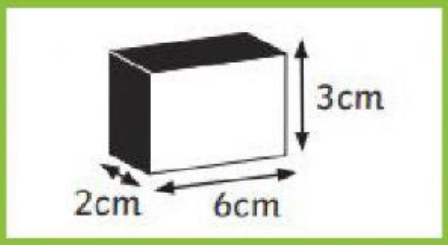

cm^3

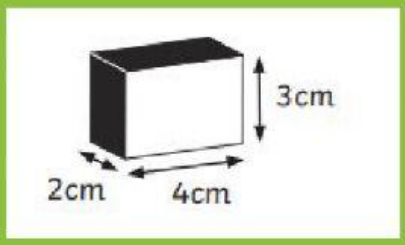

cm^3

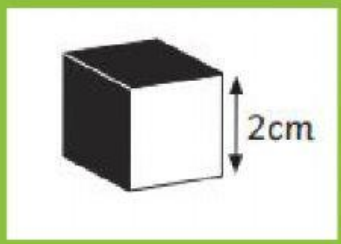

cm^3

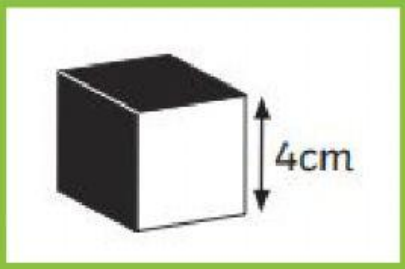

cm^3

LIVEWORKSHEETS