1. Isikan rumus luas segiempat sama :

Luas ☐ = ☐ x ☐

2. Isikan rumus luas segiempat tepat :

Luas ☐ = ☐ x ☐

3. Isikan rumus luas segitiga :

Luas △ = (☐ x ☐) ÷ ☐

4. Hitung luas segiempat dan segitiga yang berwarna di bawah:

a)

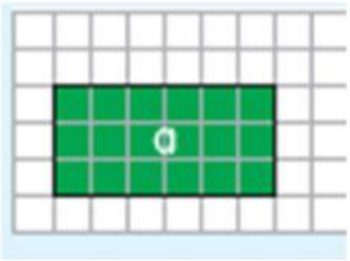

Luas = panjang x lebar

= ☐ unit x ☐ unit

= ☐ unit²

b)

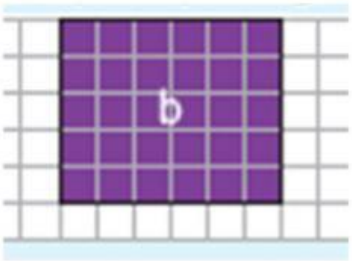

Luas = panjang x lebar

= ☐ unit x ☐ unit

= ☐ unit²

c)

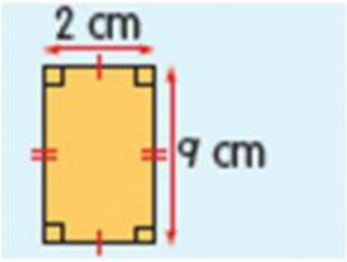

Luas = panjang x lebar

= ☐ cm x ☐ cm

= ☐ cm²

d)

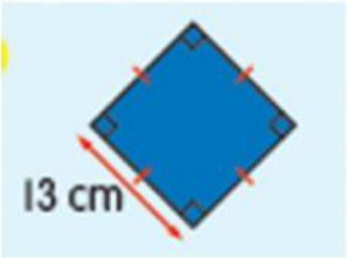

Luas = panjang x lebar

= ☐ unit x ☐ unit

= ☐ unit²

LIVEWORKSHEETS

e)

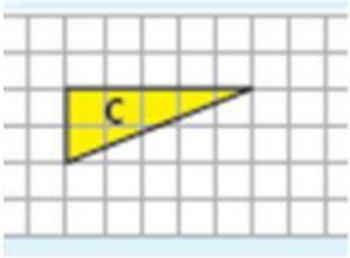

Luas = (tapak x tinggi) ÷ 2

= (☐ x ☐) ÷ 2

= ☐ unit²

f)

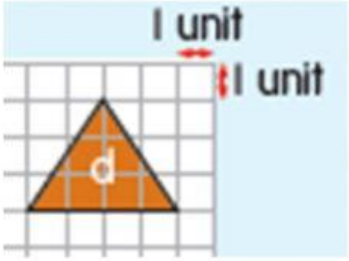

Luas = (tapak x tinggi) ÷ 2

= (☐ x ☐) ÷ 2

= ☐ unit²

g)

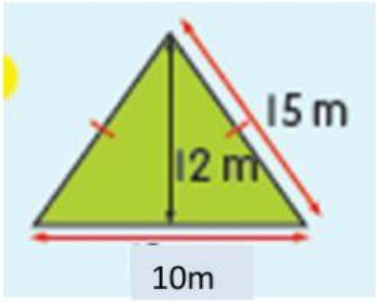

Luas = (tapak x tinggi) ÷ 2

= (☐ x ☐) ÷ 2

= ☐ m²

h)

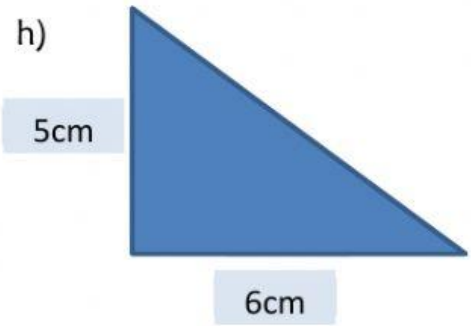

Luas = (tapak x tinggi) ÷ 2

= (☐ x ☐) ÷ 2

= ☐ cm²

i)

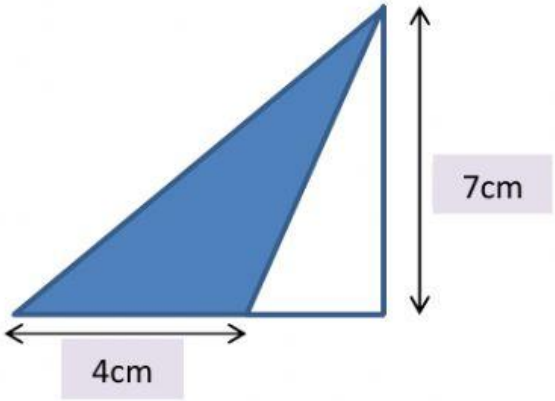

Luas = (tapak x tinggi) ÷ 2

= (☐ x ☐) ÷ 2

= ☐ cm²

LIVEWORKSHEETS