Sejarah Tingkatan 2
Bab 10-Sarawak dan Sabah

Lengkapkan jadual di bawah mengenai kegiatan ekonomi Sarawak.

Lokasi	Kegiatan	Kaum
• Pesisir Pantai	▶ _____ ▶ _____ ▶ _____ ▶ _____	☐ Melayu ☐ Kedayan ☐ Melanau
• Lembah Sungai	▶ _____ ▶ _____ _____	☐ Melayu ☐ Iban ☐ Bisaya ☐ Melanau ☐ Bidayuh
• Pedalaman	▶ _____ ▶ _____ ▶ _____	☐ Kenyah ☐ Iban ☐ Penan ☐ Kayan ☐ Kelabit ☐ Punan

Lengkapkan jadual berikut mengenai kegiatan ekonomi Sabah.

Lokasi	Kegiatan	Kaum
• Pesisir Pantai	▶ _____ ▶ _____ ▶ _____ ▶ _____	☐ Berunai ☐ Bajau / Sama ☐ Iranun ☐ Suluk
• Lembah Sungai	▶ _____ ▶ _____ _____	☐ Kadazandusun ☐ Rungus ☐ Orang Sungai
• Pedalaman	▶ _____ ▶ _____ ▶ _____	☐ Murut

@CikguLaila
LIVEWORKSHEETS

Sejarah Tingkatan 2
Bab 10-Sarawak dan Sabah

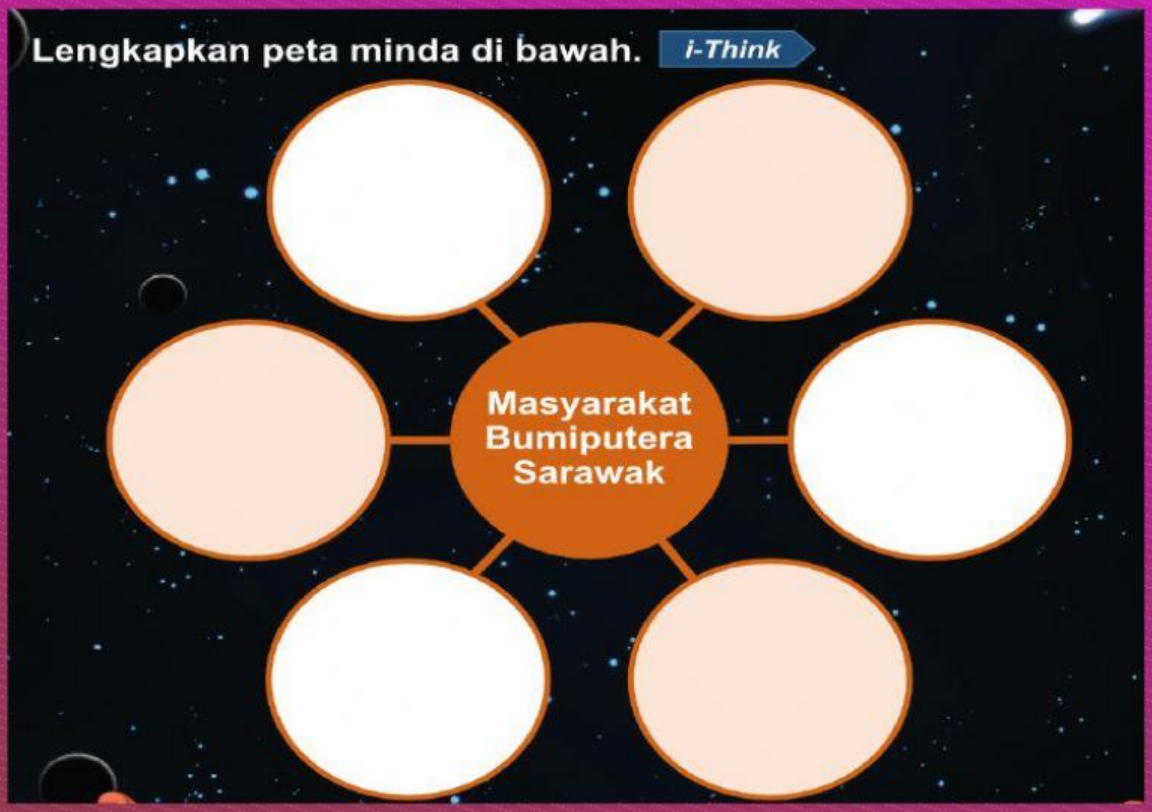



@CikguLaila

LIVEWORKSHEETS

Sejarah Tingkatan 2
Bab 10-Sarawak dan Sabah

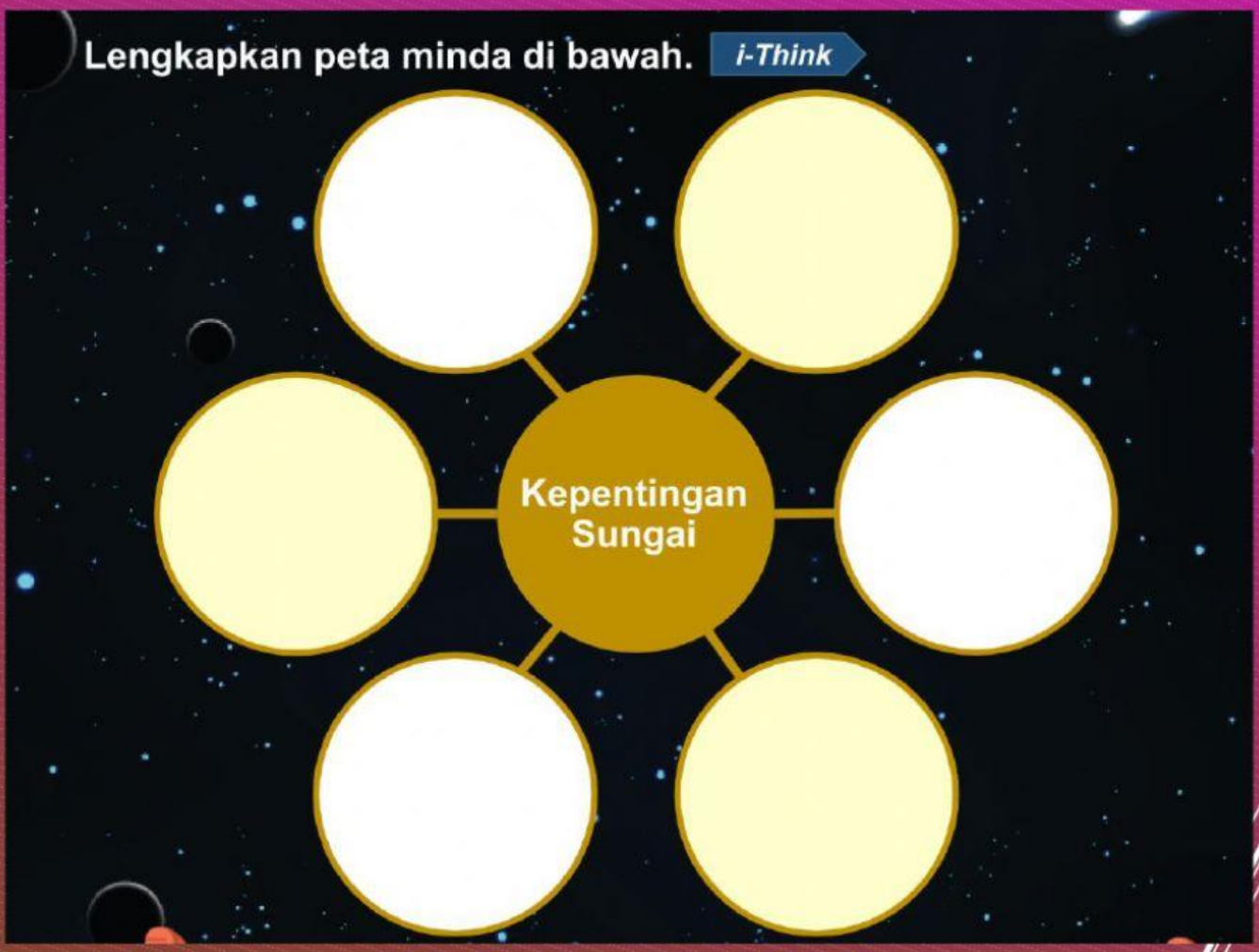

@CikguLaila

LIVEWORKSHEETS