Two Step Checkmate

Write the notation



1. White
2. Black
3. White



1. White
2. Black
3. White



1. Black
2. White
3. Black

LIVEWORKSHEETS