Name: | Date: 30.8.2021 | Class: 2C

1. Disassemble the model of a helicopter below in order by writing numbers 1 to 5.

PL 3

(a)



(b)

(c)



(d)



(e)



2. The components above need to be stored in a storage container. Mark (✓) the suitable container to store the components above.

(a)

(b)



(c)

LIVEWORKSHEETS