Guía Fracciones Impropias y Números Mixtos

1. Escribe la fracción impropia y el número mixto que corresponde a cada representación gráfica.

Representación gráfica	Fracción Impropia	Número Mixto
		
		
		

LIVEWORKSHEETS