2nd Grade **MUNDO INFANTIL SCHOOL MATH TEST** **III PARTIAL 25%**

- Write the multiplication represented in the pictures.



key rings with keys each

× =

palm trees with coconuts each

× =

- Write a multiplication to represent each situation.

× =

× =



× =



× =

LIVEWORKSHEETS

Complete the table.

Addition	Multiplication	Product
3 + 3 + 3 + 3 + 3 + 3 + 3	7 × 3	21
8 + 8 + 8 + 8 + 8 + 8 + 8		56
	7 × 2	
9 + 9 + 9 + 9 + 9 + 9 + 9		
	7 × 7	49

- Write each addition as a multiplication and write the product.

3 + 3 + 3 + 3 + 3 + 3 + 3 + 3 → 8 × 3 = 24

5 + 5 + 5 + 5 + 5 + 5 + 5 + 5 → ___ × ___ = ___

6 + 6 + 6 + 6 + 6 + 6 + 6 + 6 → ___ × ___ = ___

- Write the quotients and find the names of the cats.

32 ÷ 8 = ___

6

Kitty

54 ÷ 9 = ___

10

Meow

40 ÷ 8 = ___

4

Cutie

90 ÷ 9 = ___

5

Tickles

LIVEWORKSHEETS

- Match each situation with its division sentence and its quotient.

40 apples in 5 baskets	20 ÷ 4	8
20 candies in 4 bags	40 ÷ 5	10
20 keys in 5 keyrings	40 ÷ 4	4
40 balls in 4 boxes	20 ÷ 5	5

LIVEWORKSHEETS