SD BOPKRI GODEAN SIDOMULYO

LEMBAR KERJA PESERTA DIDIK

KELAS II

TEMA 2: BERMAIN DI LINGKUNGANKU

SUBTEMA 2: BERMAIN DI RUMAH TEMAN

PEMEBALAJARAN 4

LIVEWORKSHEETS

Contoh:

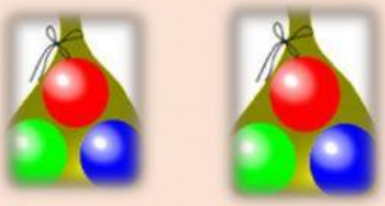

3 + 3 = 6

2 X 3 = 6

Tentukan bilangan yang tepat untuk soal berikut!

1. 

+ + + =

X =

2.

+ + =

X =

LIVEWORKSHEETS

Isilah kotak yang kosong dengan bilangan yang tepat dan pilihlah jawaban yang paling tepat!

3.

X =

4.



X =

5.



X =

LIVEWORKSHEETS

Amatilah benda dibawah ini kemudian cocokan benda tersebut berdasarkan wujudnya!

6.

- **Benda gas**

7.

- **Benda cair**

8.

- **Benda padat**

9.

- **Benda padat**

10.

- **Benda cair**

LIVEWORKSHEETS