D Tandakan (✔) pada petak yang digunakan untuk menganggar luas permukaan bentuk-bentuk berikut. Kemudian, tuliskan anggaran luas permukaan bagi setiap bentuk. SP 6.1.3 TP 4

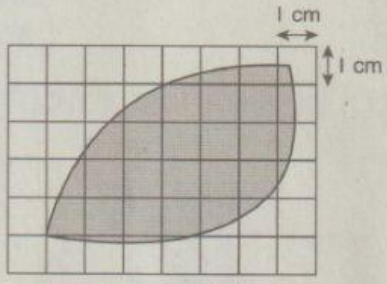

1. cm²

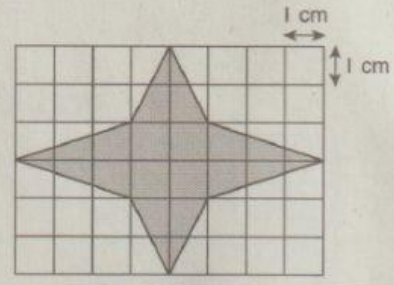

2. cm²

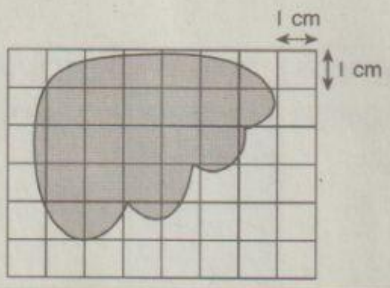

3. cm²

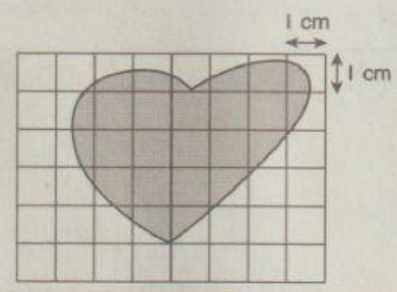

4. cm²

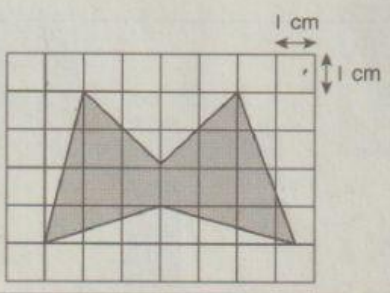

5. cm²

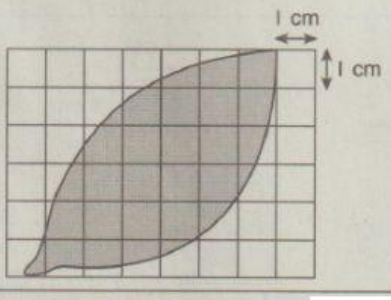

6. cm²

LIVEWORKSHEETS