BAB 8: UNSUR dan BAHAN (posisi unsur) by Cikgu Shukri

Rajah menunjukkan unsur W, X, Y dan Z. Nyatakan posisi setiap unsur tersebut.

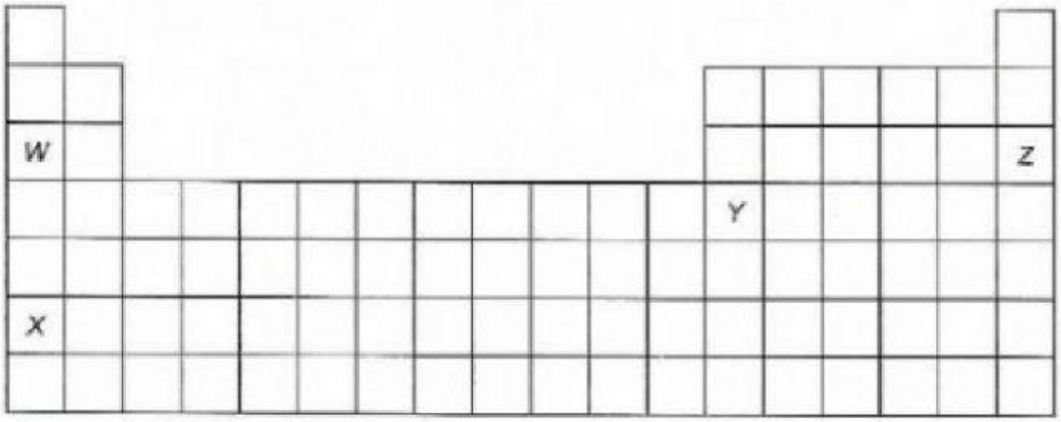

W → kumpulan:_____, Kala:_____

X → kumpulan:_____, Kala:_____

Y → kumpulan:_____, Kala:_____

Z → kumpulan:_____, Kala:_____

LIVEWORKSHEETS

Sila nyatakan posisi bagi atom-atom berikut.

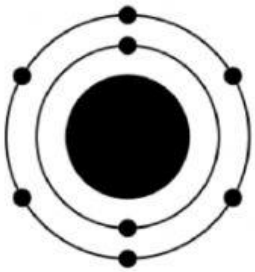

kumpulan:_____, Kala:_____

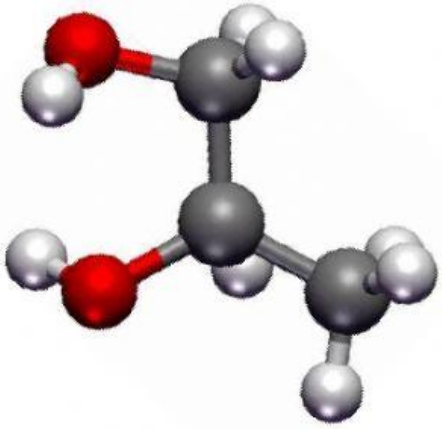



kumpulan:_____, Kala:_____

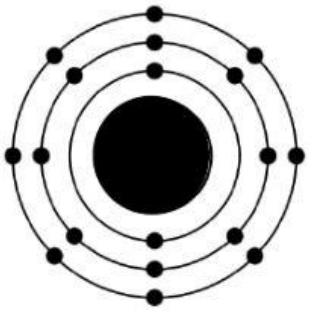

kumpulan:_____, Kala:_____

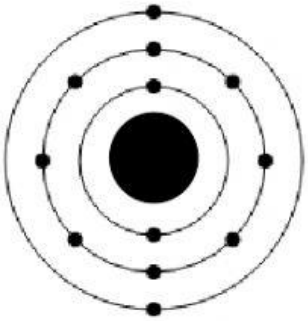

kumpulan:_____, Kala:_____



LIVEWORKSHEETS