长度练习 19/8/2021

A 哪个是米，哪个是厘米？写一写。

1 ☐

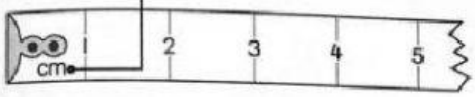

2 ☐

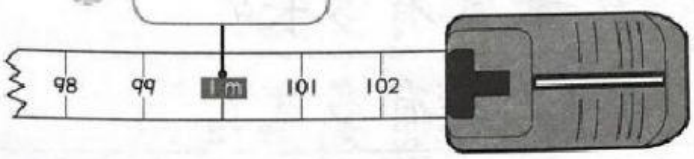

B 写出合理的长度单位（cm 或 m）。

1

11 ☐

2

5 ☐

3

60 ☐

C 写出长度。

例 7 厘米 = 7 cm　　9 m = 9 米

1 18 厘米 = ☐

2 96 cm = ☐

3 3 米 = ☐

4 64 m = ☐

C 看图写出毛线的长度。

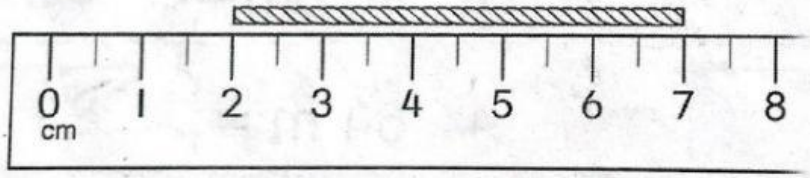

☐ cm

LIVEWORKSHEETS

估一估，选择正确的答案。

1

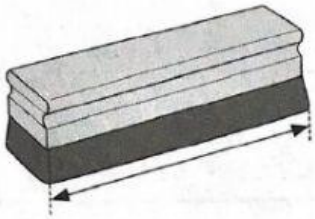

少于 1 m ☐

多于 1 m ☐

2



少于 1 m ☐

多于 1 m ☐

LIVEWORKSHEETS