Nome: _____
Escola: _____ turma: _____
Professor: _____ Data: _____

ATIVIDADE SOBRE AS HORAS

1. Ligue o relógio digital cujo o horário marcado esteja de acordo com o relógio analógico.

06:00 • • 

10:15 • • 

09:30 • • 

05:45 • • 

2. Que Horas são?

➤ ___ : ___

➤ ___ : ___

➤ ___ : ___

➤ ___ : ___

LIVEWORKSHEETS

LIVEWORKSHEETS