# Static Electricity

Tap the images that expresses static electricity.



Write whether the two objects 'attract', 'repel' or 'no effect' on each other.

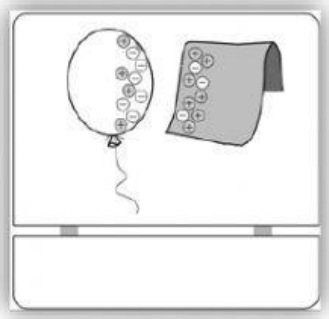


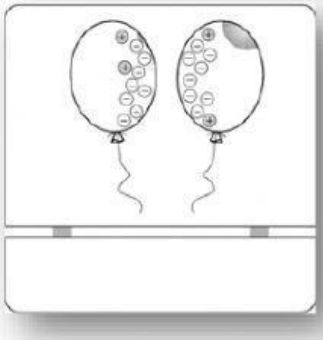
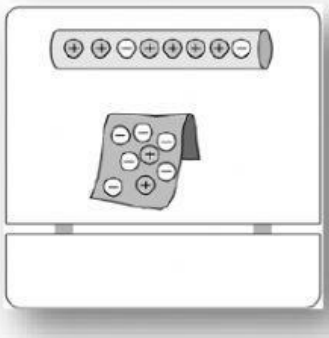

LIVEWORKSHEETS